Déterminer la Symétrie

Nom:

**Déterminez si la droite qui parcoure la figure est un axe de symétrie.**

**Ex)**

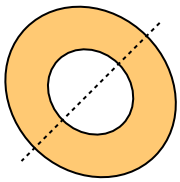

**1)**

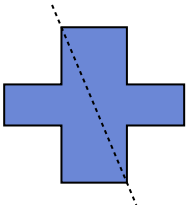

**2)**

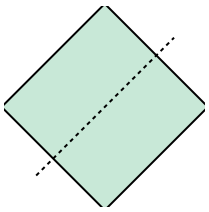

**3)**

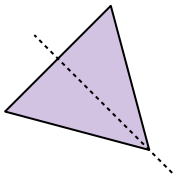

**4)**

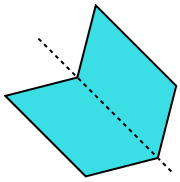

**5)**

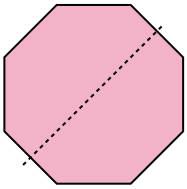

**6)**

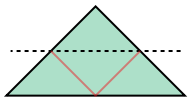

**7)**

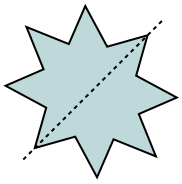

**8)**



**9)**

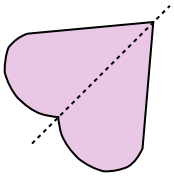

**10)**

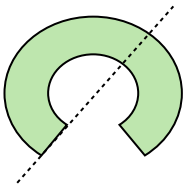

**11)**

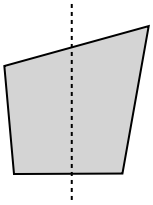

## Réponses

Ex. oui

1. _____

2. _____

3. _____

4. _____

5. _____

6. _____

7. _____

8. _____

9. _____

10. _____

11. _____



| | | | | | | | | | | |
|---|---|---|---|---|---|---|---|---|---|---|
| 1-10 | 91 | 82 | 73 | 64 | 55 | 45 | 36 | 27 | 18 | 9 |
| 11 | 0 | | | | | | | | | |

Déterminer la Symétrie

Nom: **Clé**

**Déterminez si la droite qui parcoure la figure est un axe de symétrie.**

**Ex)**

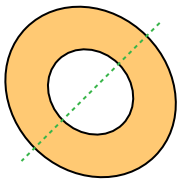

**1)**

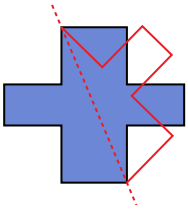

**2)**

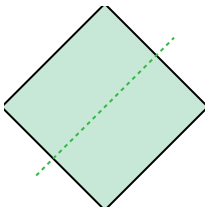

**3)**

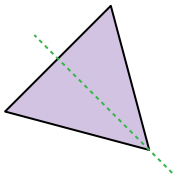

**4)**

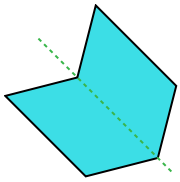

**5)**

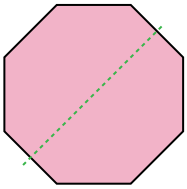

**6)**

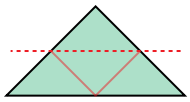

**7)**

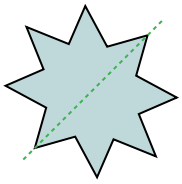

**8)**

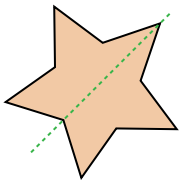

**9)**

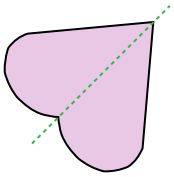

**10)**

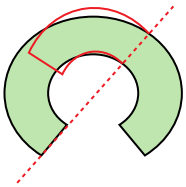

**11)**

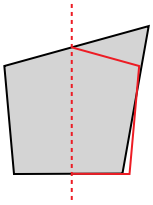

## Réponses

Ex. **oui**

1. **no**
2. **oui**
3. **oui**
4. **oui**
5. **oui**
6. **no**
7. **oui**
8. **oui**
9. **oui**
10. **no**
11. **no**



| | | | | | | | | | | |
|---|---|---|---|---|---|---|---|---|---|---|
| 1-10 | 91 | 82 | 73 | 64 | 55 | 45 | 36 | 27 | 18 | 9 |
| 11 | 0 | | | | | | | | | |