Machines à Fonctions (Additions & Soustractions) Nom:

Déterminez la règle appliquée à chaque machine à fonctions.

Ex)

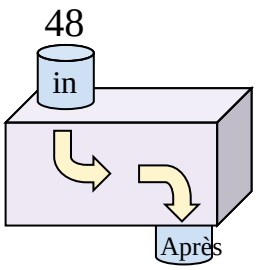

Soustraire 33

1)

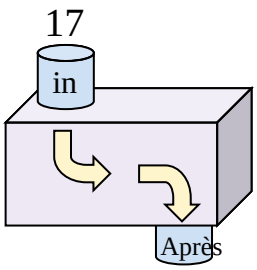

2)

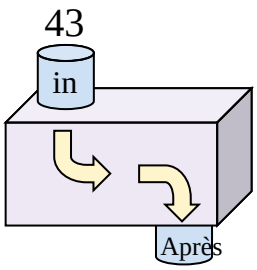

3)

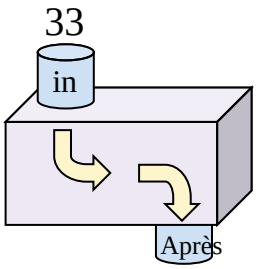

4)

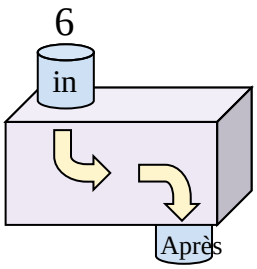

5)

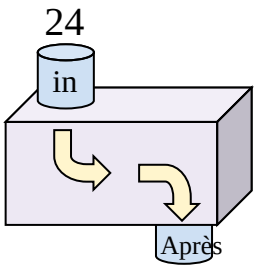

6)

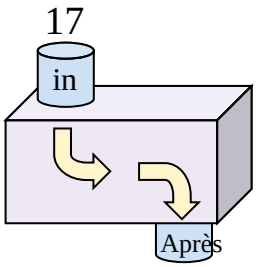

7)

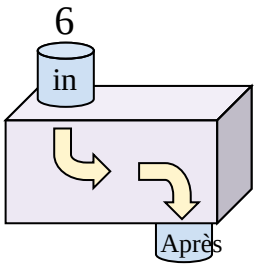

8)

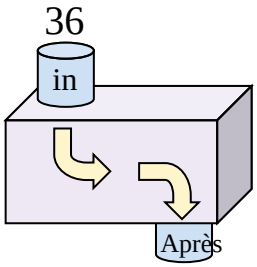

9)

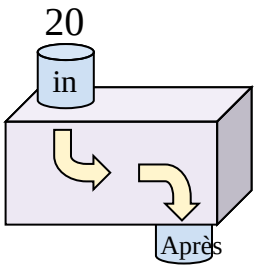

10)

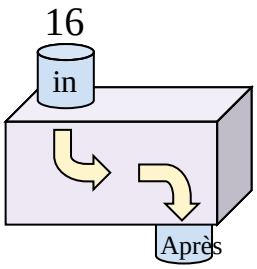

11)

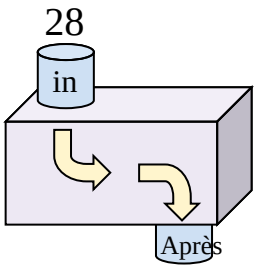

Réponses

Ex. Soustraire 33

1. _____
2. _____
3. _____
4. _____
5. _____
6. _____
7. _____
8. _____
9. _____
10. _____
11. _____

1-10	91	82	73	64	55	45	36	27	18	9
11	0									

Machines à Fonctions (Additions & Soustractions) Nom: **Clé**

Déterminez la règle appliquée à chaque machine à fonctions.

Ex)

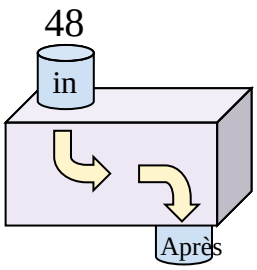

Soustraire 33

1)

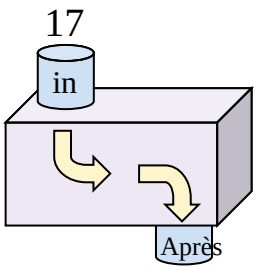

Ajouter 15

2)

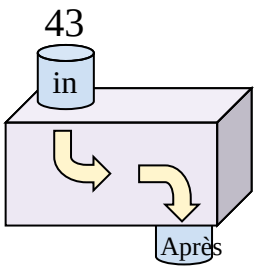

Soustraire 23

3)

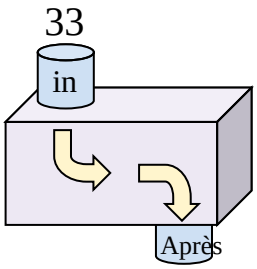

Soustraire 15

4)

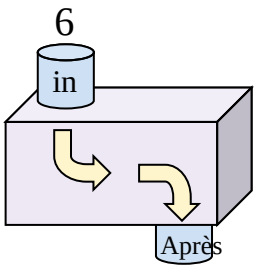

Ajouter 36

5)

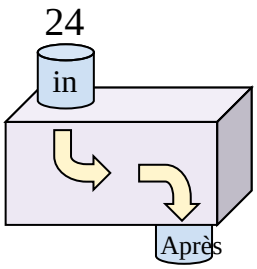

Ajouter 14

6)

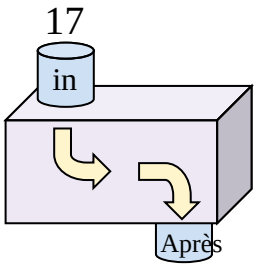

Ajouter 9

7)

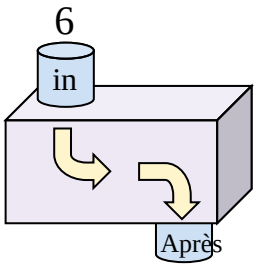

Ajouter 14

8)

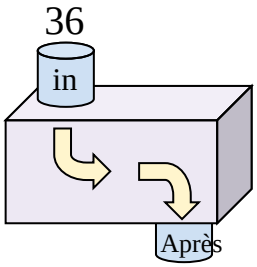

Soustraire 16

9)

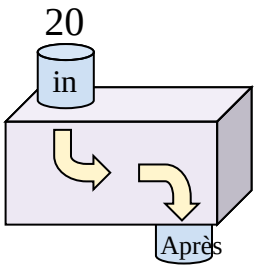

Ajouter 8

10)

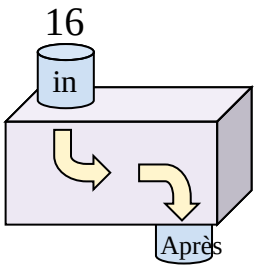

Ajouter 19

11)

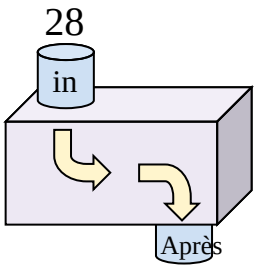

Soustraire 9

Réponses

Ex. **Soustraire 33**

1. **Ajouter 15**
2. **Soustraire 23**
3. **Soustraire 15**
4. **Ajouter 36**
5. **Ajouter 14**
6. **Ajouter 9**
7. **Ajouter 14**
8. **Soustraire 16**
9. **Ajouter 8**
10. **Ajouter 19**
11. **Soustraire 9**

1-10	91	82	73	64	55	45	36	27	18	9
11	0									