Machines à Fonctions (Additions & Soustractions) Nom:

Déterminez la règle appliquée à chaque machine à fonctions.

Ex)

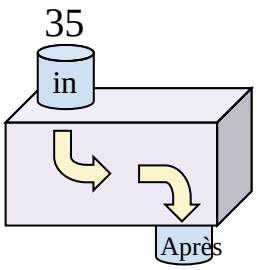

Soustraire 13

1)

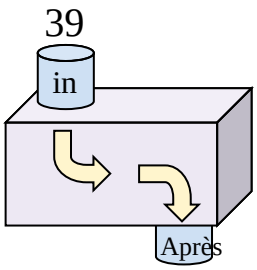

2)

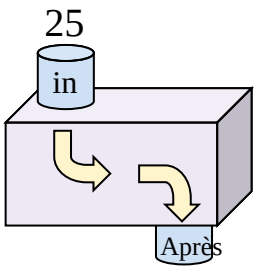

3)

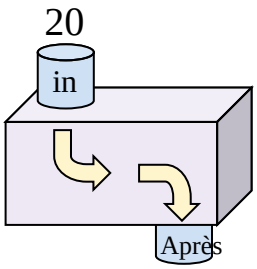

4)

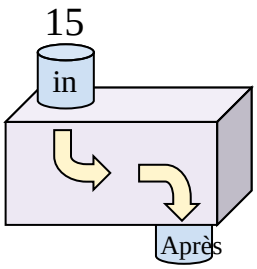

5)

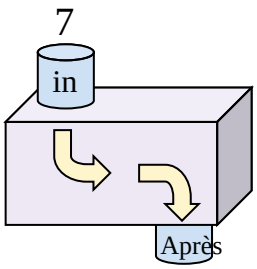

6)

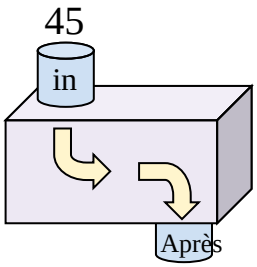

7)

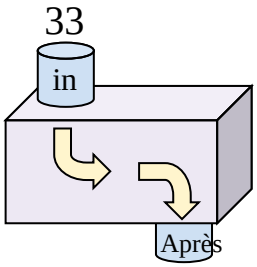

8)

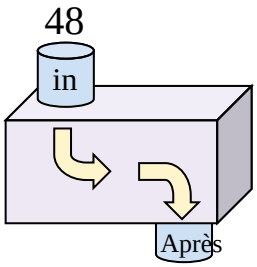

9)

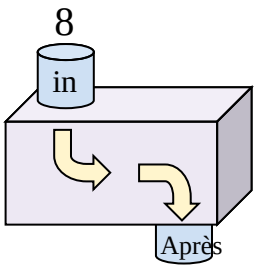

10)

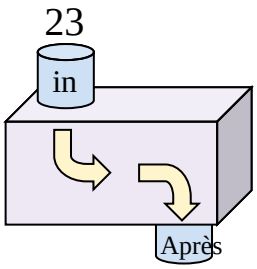

11)

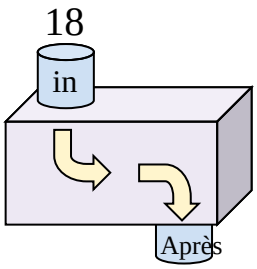

Réponses

Ex. Soustraire 13

1. _____
2. _____
3. _____
4. _____
5. _____
6. _____
7. _____
8. _____
9. _____
10. _____
11. _____

1-10	91	82	73	64	55	45	36	27	18	9
11	0									

Machines à Fonctions (Additions & Soustractions) Nom: **Clé**

Déterminez la règle appliquée à chaque machine à fonctions.

Ex)

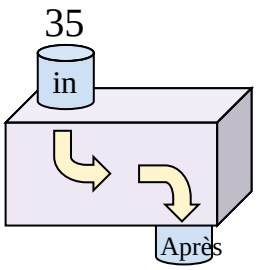

Soustraire 13

1)

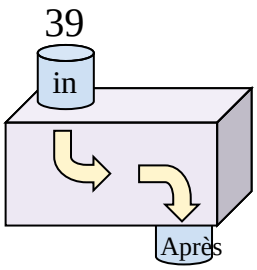

Soustraire 31

2)

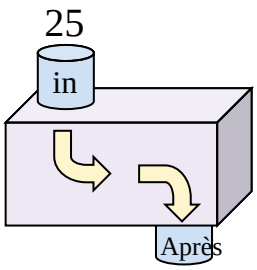

Ajouter 10

3)

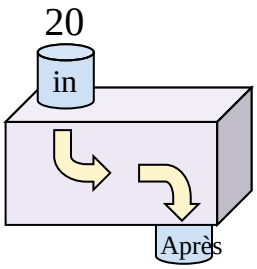

Ajouter 8

4)

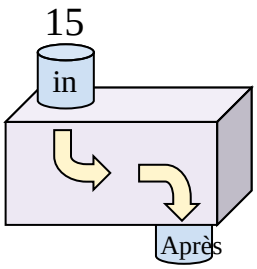

Ajouter 34

5)

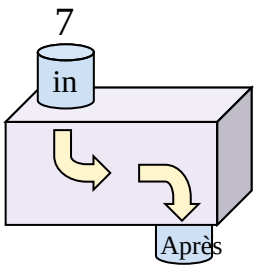

Ajouter 21

6)

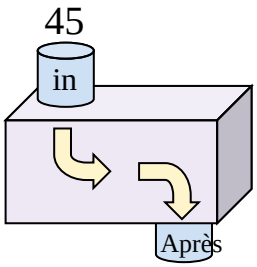

Soustraire 21

7)

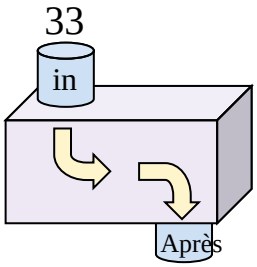

Soustraire 13

8)

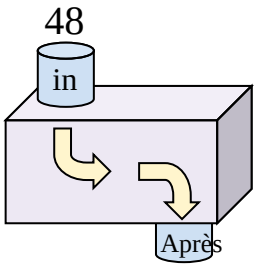

Soustraire 28

9)

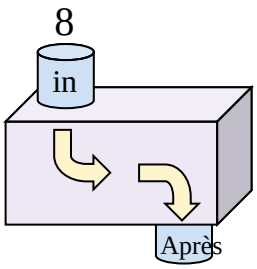

Ajouter 38

10)

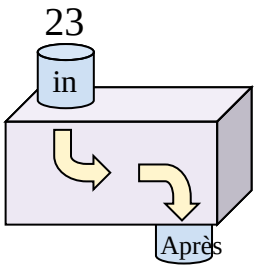

Ajouter 12

11)

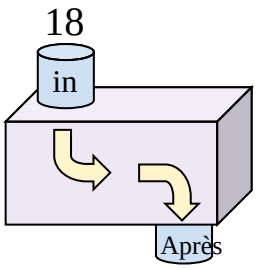

Ajouter 6

Réponses

Ex. **Soustraire 13**

1. **Soustraire 31**
2. **Ajouter 10**
3. **Ajouter 8**
4. **Ajouter 34**
5. **Ajouter 21**
6. **Soustraire 21**
7. **Soustraire 13**
8. **Soustraire 28**
9. **Ajouter 38**
10. **Ajouter 12**
11. **Ajouter 6**

1-10	91	82	73	64	55	45	36	27	18	9
11	0									