Machines à Fonctions (Additions & Soustractions) Nom:

Déterminez la règle appliquée à chaque machine à fonctions.

Ex)

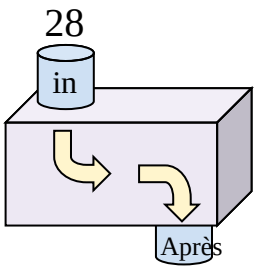

Ajouter 8

1)

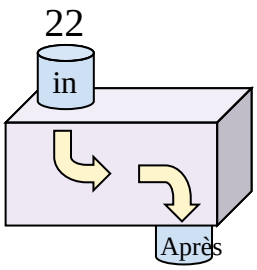

2)

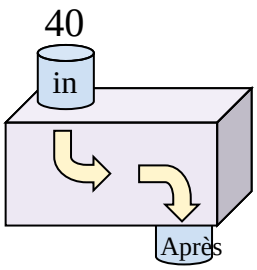

3)

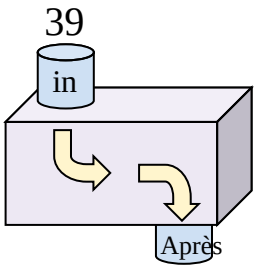

4)

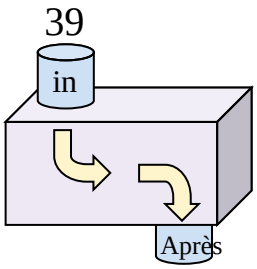

5)

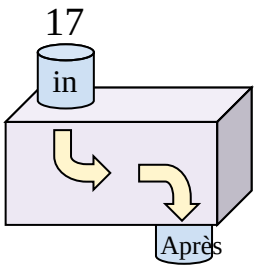

6)

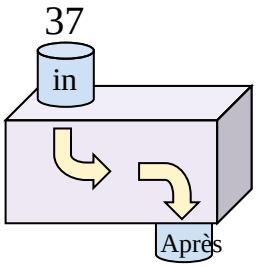

7)

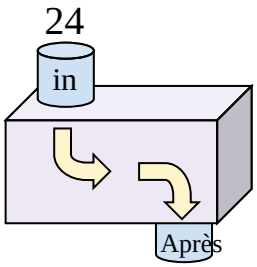

8)

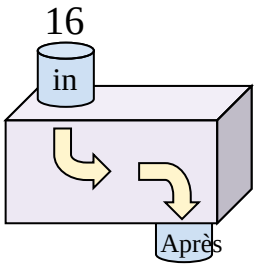

9)

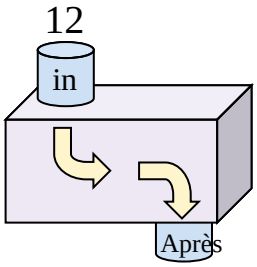

10)

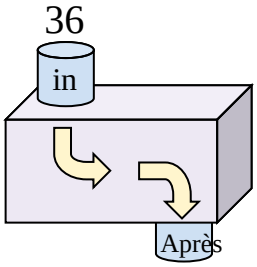

11)

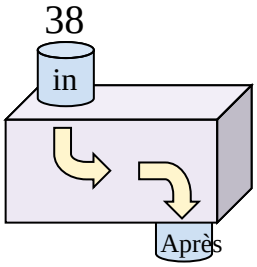

Réponses

Ex. Ajouter 8

1. _____
2. _____
3. _____
4. _____
5. _____
6. _____
7. _____
8. _____
9. _____
10. _____
11. _____

1-10	91	82	73	64	55	45	36	27	18	9
11	0									

Machines à Fonctions (Additions & Soustractions) Nom: **Clé**

Déterminez la règle appliquée à chaque machine à fonctions.

Ex)

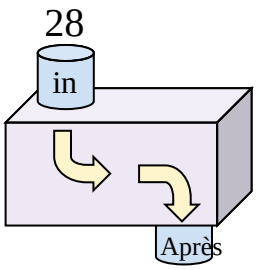

Ajouter 8

1)

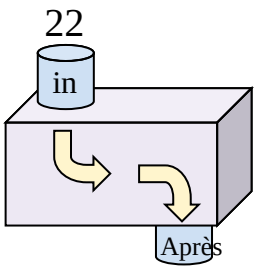

Ajouter 6

2)

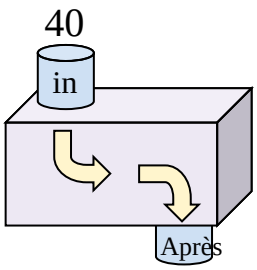

Soustraire 16

3)

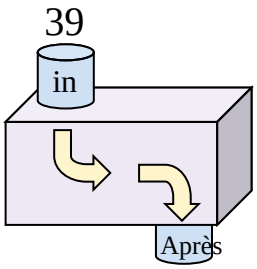

Soustraire 17

4)

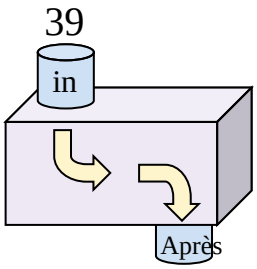

Soustraire 32

5)

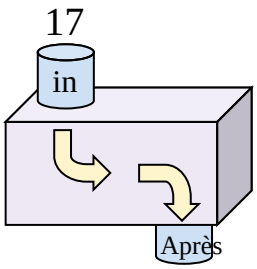

Soustraire 6

6)

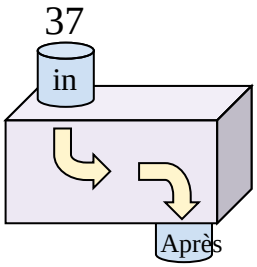

Soustraire 14

7)

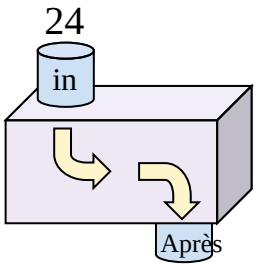

Ajouter 18

8)

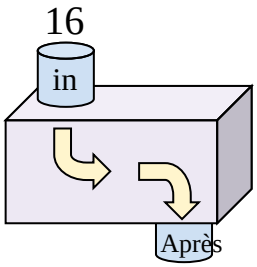

Ajouter 33

9)

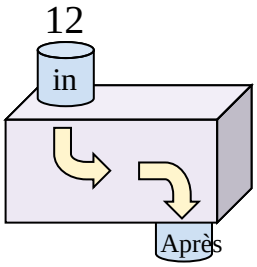

Ajouter 34

10)

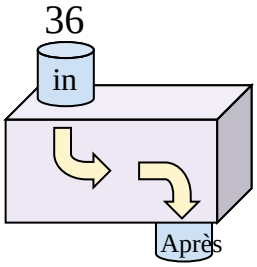

Soustraire 26

11)

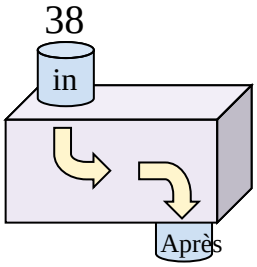

Soustraire 9

Réponses

Ex. **Ajouter 8**

1. **Ajouter 6**
2. **Soustraire 16**
3. **Soustraire 17**
4. **Soustraire 32**
5. **Soustraire 6**
6. **Soustraire 14**
7. **Ajouter 18**
8. **Ajouter 33**
9. **Ajouter 34**
10. **Soustraire 26**
11. **Soustraire 9**

1-10	91	82	73	64	55	45	36	27	18	9
11	0									