Machines à Fonctions (Additions & Soustractions) Nom:

Déterminez la règle appliquée à chaque machine à fonctions.

Ex)

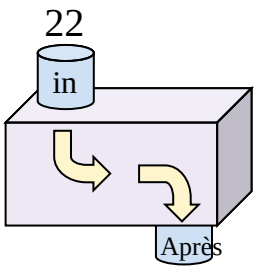

Ajouter 20

1)

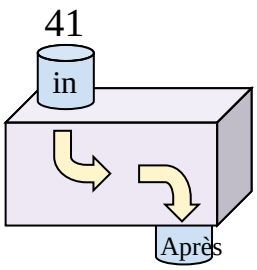

2)

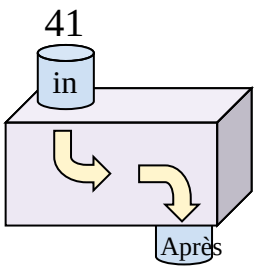

3)

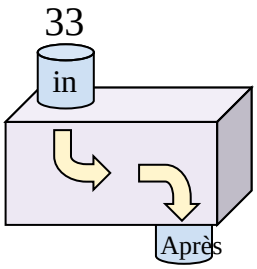

4)

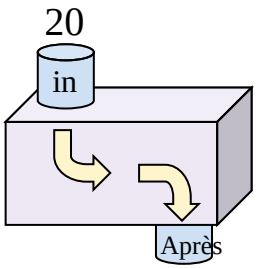

5)

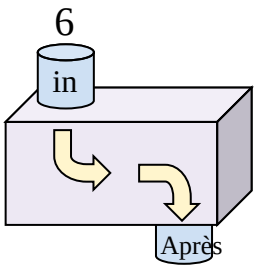

6)

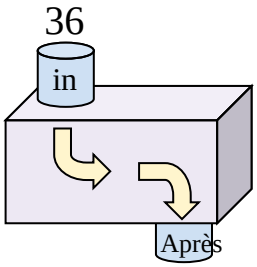

7)

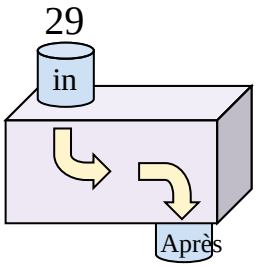

8)

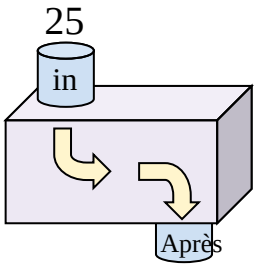

9)

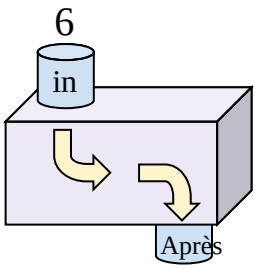

10)

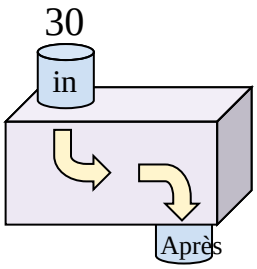

11)

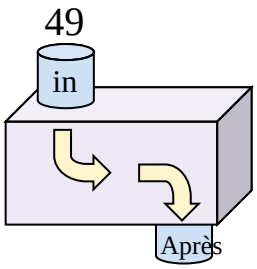

Réponses

Ex. Ajouter 20

1. _____
2. _____
3. _____
4. _____
5. _____
6. _____
7. _____
8. _____
9. _____
10. _____
11. _____

1-10	91	82	73	64	55	45	36	27	18	9
11	0									

Machines à Fonctions (Additions & Soustractions) Nom: **Clé**

Déterminez la règle appliquée à chaque machine à fonctions.

Ex)

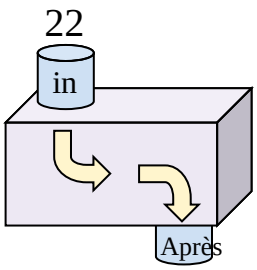

Ajouter 20

1)

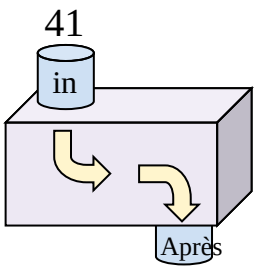

Soustraire 18

2)

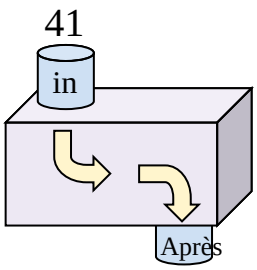

Soustraire 33

3)

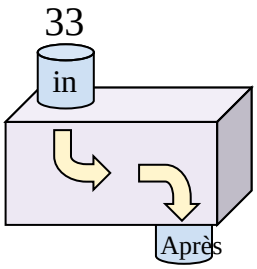

Soustraire 16

4)

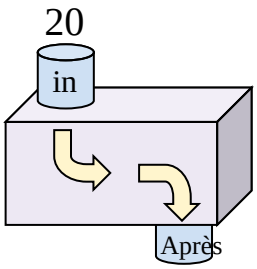

Soustraire 8

5)

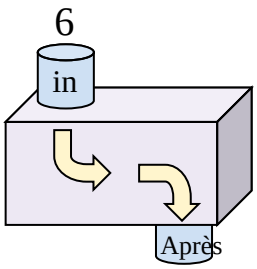

Ajouter 37

6)

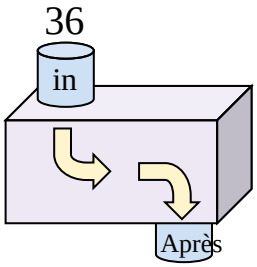

Soustraire 11

7)

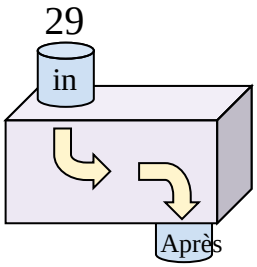

Ajouter 15

8)

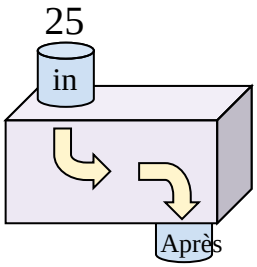

Ajouter 25

9)

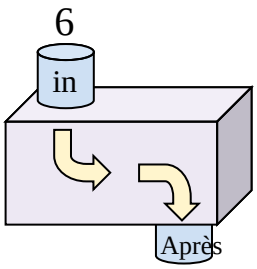

Ajouter 10

10)

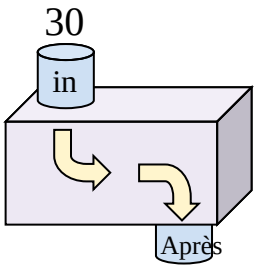

Soustraire 16

11)

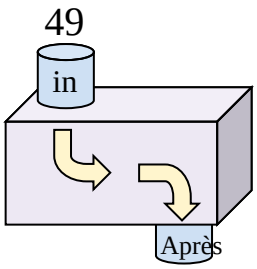

Soustraire 29

Réponses

Ex. **Ajouter 20**

1. **Soustraire 18**
2. **Soustraire 33**
3. **Soustraire 16**
4. **Soustraire 8**
5. **Ajouter 37**
6. **Soustraire 11**
7. **Ajouter 15**
8. **Ajouter 25**
9. **Ajouter 10**
10. **Soustraire 16**
11. **Soustraire 29**

1-10	91	82	73	64	55	45	36	27	18	9
11	0									