Machines à Fonctions (Additions & Soustractions) Nom:

Déterminez la règle appliquée à chaque machine à fonctions.

Ex)

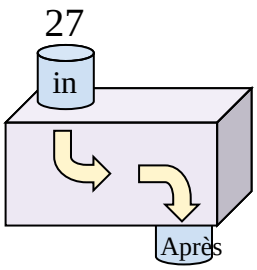

Soustraire 5

1)

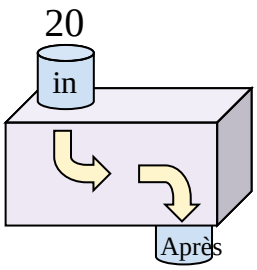

2)

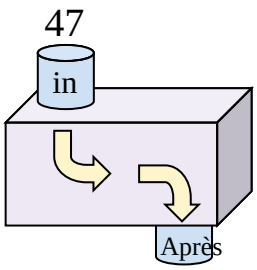

3)

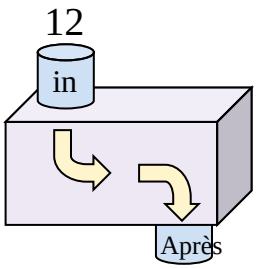

4)

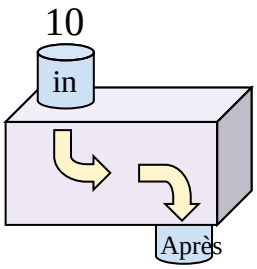

5)

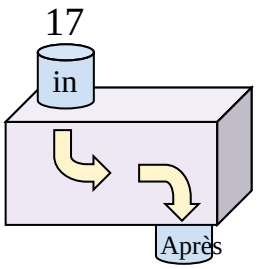

6)

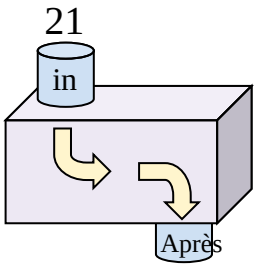

7)

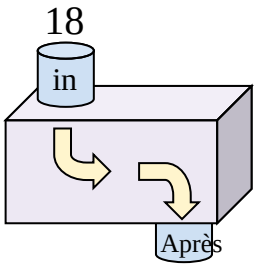

8)

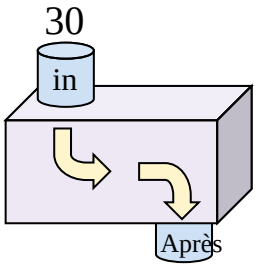

9)

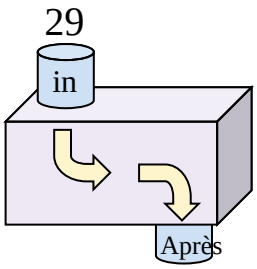

10)

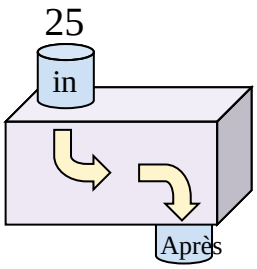

11)

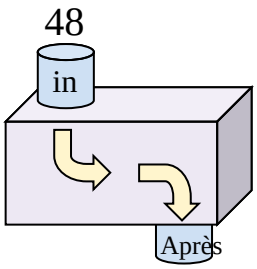

Réponses

Ex. **Soustraire 5**

1. _____
2. _____
3. _____
4. _____
5. _____
6. _____
7. _____
8. _____
9. _____
10. _____
11. _____

1-10	91	82	73	64	55	45	36	27	18	9
11	0									

Machines à Fonctions (Additions & Soustractions) Nom: **Clé**

Déterminez la règle appliquée à chaque machine à fonctions.

Ex)

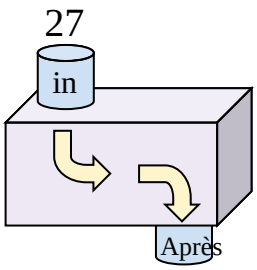

Soustraire 5

1)

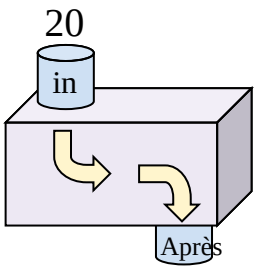

Ajouter 14

2)

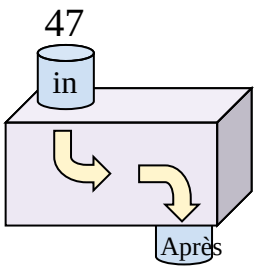

Soustraire 33

3)

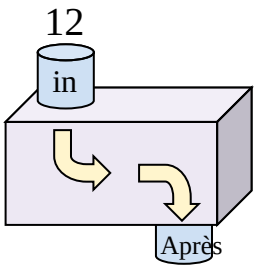

Ajouter 27

4)

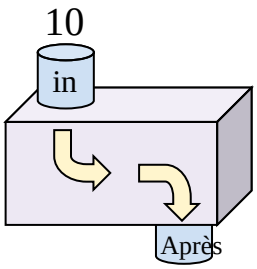

Ajouter 30

5)

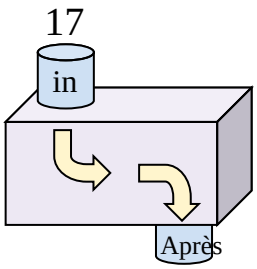

Ajouter 25

6)

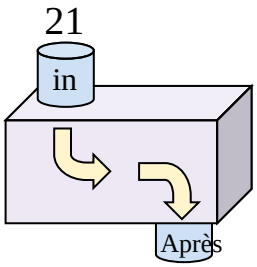

Ajouter 24

7)

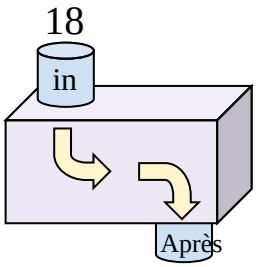

Soustraire 12

8)

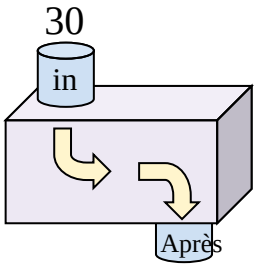

Soustraire 6

9)

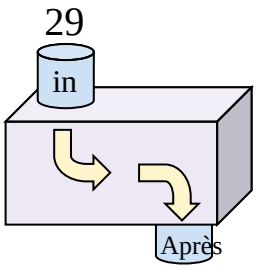

Ajouter 18

10)

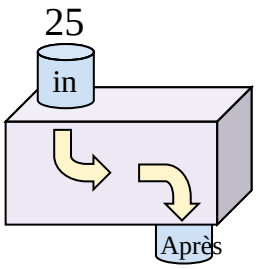

Ajouter 5

11)

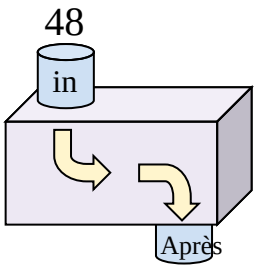

Soustraire 31

Réponses

Ex. **Soustraire 5**

1. **Ajouter 14**
2. **Soustraire 33**
3. **Ajouter 27**
4. **Ajouter 30**
5. **Ajouter 25**
6. **Ajouter 24**
7. **Soustraire 12**
8. **Soustraire 6**
9. **Ajouter 18**
10. **Ajouter 5**
11. **Soustraire 31**

1-10	91	82	73	64	55	45	36	27	18	9
11	0									