Machines à Fonctions (Additions & Soustractions) Nom:

Déterminez la règle appliquée à chaque machine à fonctions.

Ex)

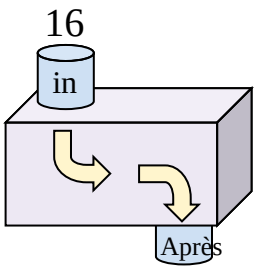

Ajouter 12

1)

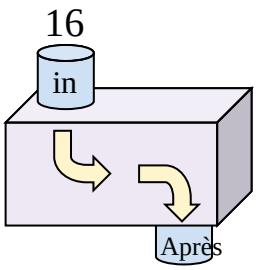

2)

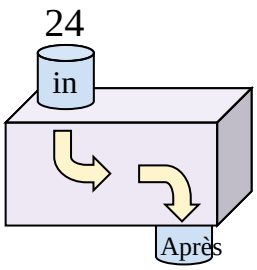

3)

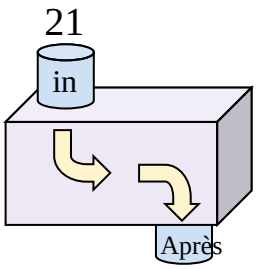

4)

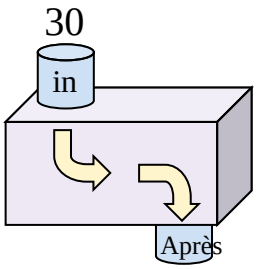

5)

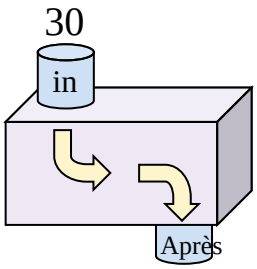

6)

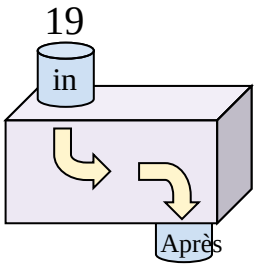

7)

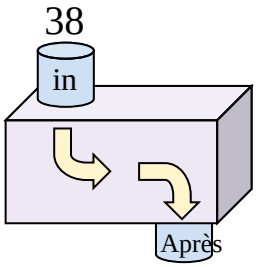

8)

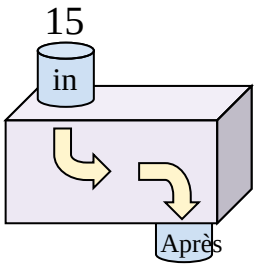

9)

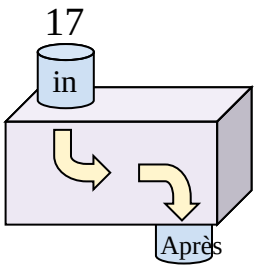

10)

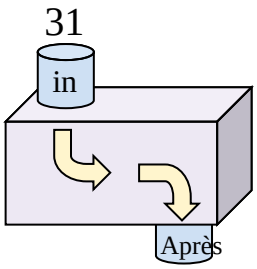

11)

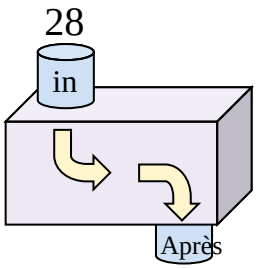

Réponses

Ex. Ajouter 12

1. _____
2. _____
3. _____
4. _____
5. _____
6. _____
7. _____
8. _____
9. _____
10. _____
11. _____

1-10	91	82	73	64	55	45	36	27	18	9
11	0									

Machines à Fonctions (Additions & Soustractions) Nom: **Clé**

Déterminez la règle appliquée à chaque machine à fonctions.

Ex)

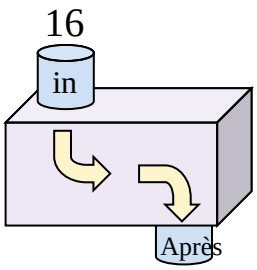

Ajouter 12

1)

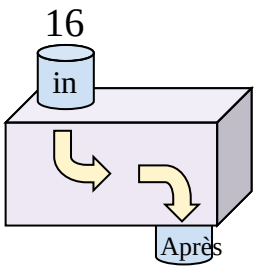

Ajouter 6

2)

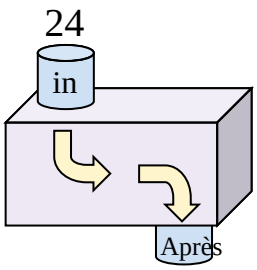

Soustraire 17

3)

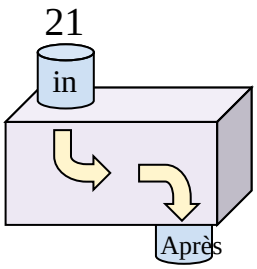

Ajouter 14

4)

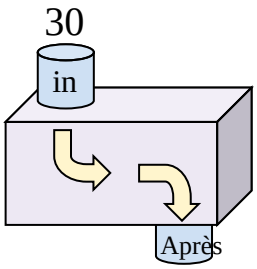

Soustraire 17

5)

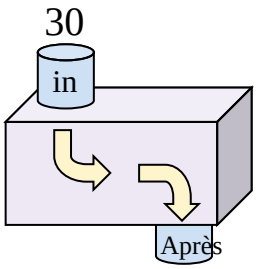

Soustraire 7

6)

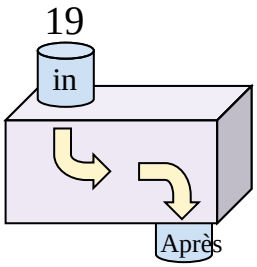

Ajouter 13

7)

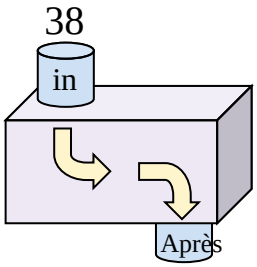

Soustraire 17

8)

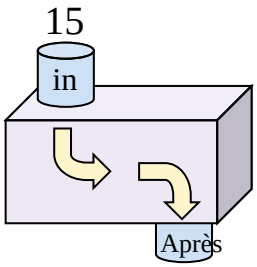

Ajouter 8

9)

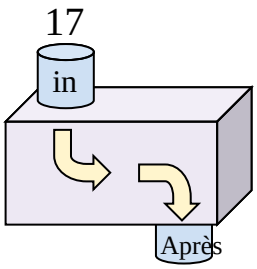

Ajouter 15

10)

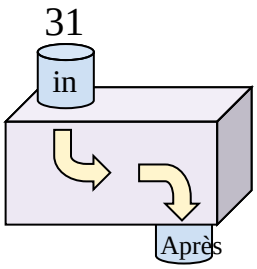

Soustraire 24

11)

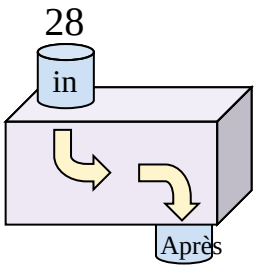

Soustraire 18

Réponses

Ex. **Ajouter 12**

1. **Ajouter 6**
2. **Soustraire 17**
3. **Ajouter 14**
4. **Soustraire 17**
5. **Soustraire 7**
6. **Ajouter 13**
7. **Soustraire 17**
8. **Ajouter 8**
9. **Ajouter 15**
10. **Soustraire 24**
11. **Soustraire 18**

1-10	91	82	73	64	55	45	36	27	18	9
11	0									