# Multiplication de Fractions (visuelle)

Nom:

**Utilisez la grille comme exemple afin de multiplier les deux fractions.**

**Ex)** $\frac{2}{5} \times \frac{3}{8} =$

**1)** $\frac{2}{3} \times \frac{3}{5} =$

**2)** $\frac{2}{6} \times \frac{7}{8} =$

**3)** $\frac{5}{8} \times \frac{1}{4} =$

**4)** $\frac{1}{4} \times \frac{6}{8} =$

**5)** $\frac{2}{8} \times \frac{7}{8} =$

**6)** $\frac{1}{2} \times \frac{1}{3} =$

**7)** $\frac{1}{2} \times \frac{4}{7} =$

**8)** $\frac{3}{9} \times \frac{3}{4} =$

**9)** $\frac{2}{9} \times \frac{3}{4} =$

**10)** $\frac{4}{6} \times \frac{1}{6} =$

**11)** $\frac{2}{3} \times \frac{7}{8} =$

**Réponses**

Ex. $\frac{6}{40}$

1. _____
2. _____
3. _____
4. _____
5. _____
6. _____
7. _____
8. _____
9. _____
10. _____
11. _____



| | | | | | | | | | | |
|---|---|---|---|---|---|---|---|---|---|---|
| 1-10 | 91 | 82 | 73 | 64 | 55 | 45 | 36 | 27 | 18 | 9 |
| 11 | 0 | | | | | | | | | |

Multiplication de Fractions (visuelle) Nom: **Clé**

**Utilisez la grille comme exemple afin de multiplier les deux fractions.**

**Ex)** $\frac{2}{5} \times \frac{3}{8} =$

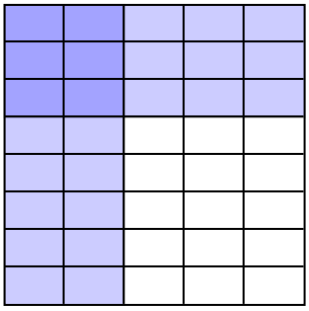

**1)** $\frac{2}{3} \times \frac{3}{5} =$

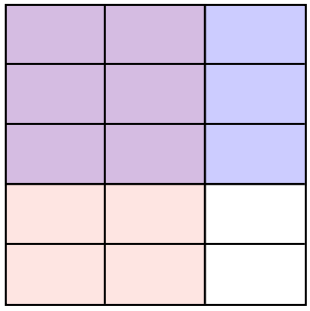

**2)** $\frac{2}{6} \times \frac{7}{8} =$

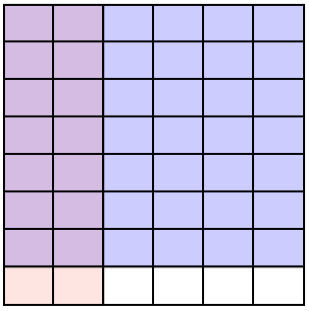

**3)** $\frac{5}{8} \times \frac{1}{4} =$

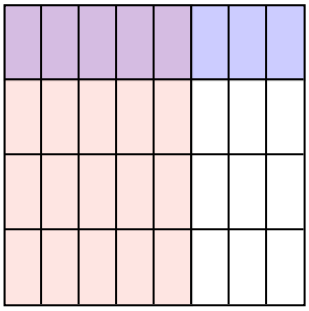

**4)** $\frac{1}{4} \times \frac{6}{8} =$

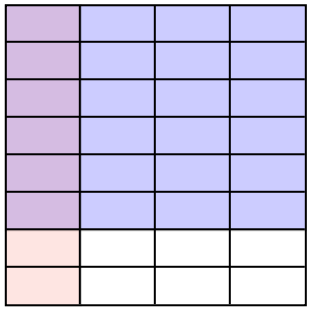

**5)** $\frac{2}{8} \times \frac{7}{8} =$

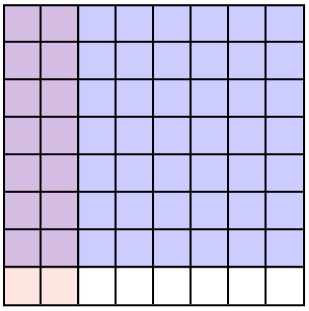

**6)** $\frac{1}{2} \times \frac{1}{3} =$



**7)** $\frac{1}{2} \times \frac{4}{7} =$

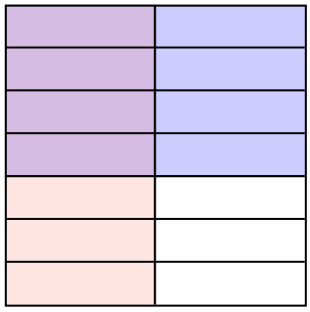

**8)** $\frac{3}{9} \times \frac{3}{4} =$

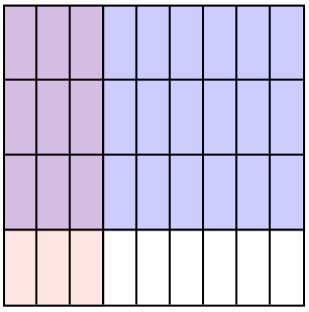

**9)** $\frac{2}{9} \times \frac{3}{4} =$

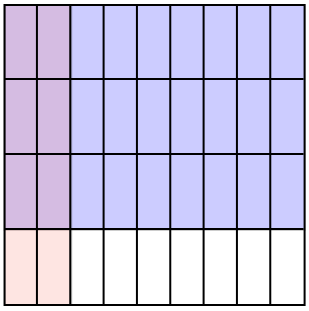

**10)** $\frac{4}{6} \times \frac{1}{6} =$

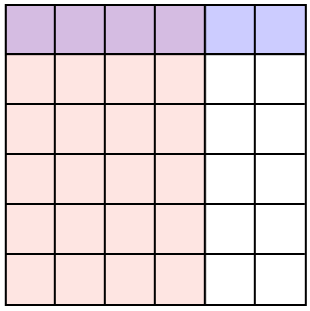

**11)** $\frac{2}{3} \times \frac{7}{8} =$

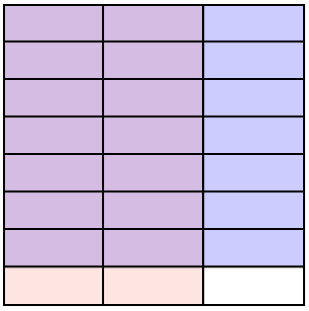

**Réponses**

| | |
|---|---|
| Ex. | 6/40 |
| 1. | 6/15 |
| 2. | 14/48 |
| 3. | 5/32 |
| 4. | 6/32 |
| 5. | 14/64 |
| 6. | 1/6 |
| 7. | 4/14 |
| 8. | 9/36 |
| 9. | 6/36 |
| 10. | 4/36 |
| 11. | 14/24 |



| | | | | | | | | | | |
|---|---|---|---|---|---|---|---|---|---|---|
| 1-10 | 91 | 82 | 73 | 64 | 55 | 45 | 36 | 27 | 18 | 9 |
| 11 | 0 | | | | | | | | | |