Diviser avec une Droite Numérique

Nom:

Utilisez la droite numérique pour résoudre chaque problème.

1) 27÷9=

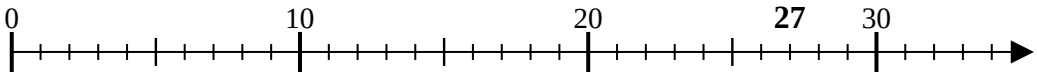

2) 18÷9=

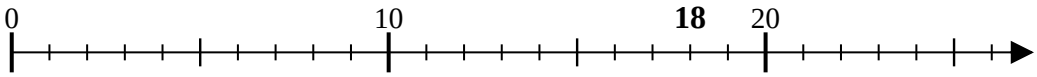

3) 32÷8=

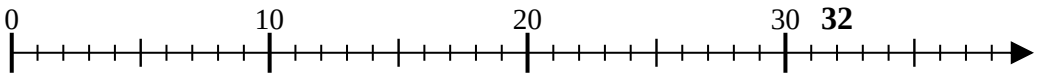

4) 8÷4=

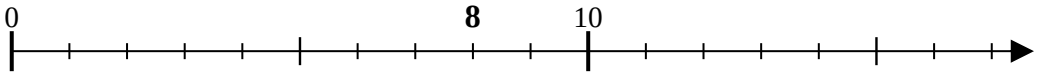

5) 40÷8=

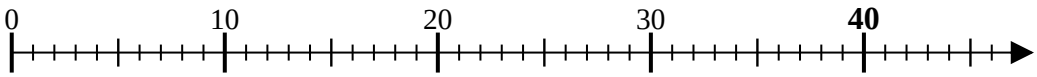

6) 15÷5=

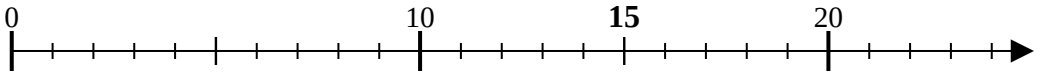

7) 24÷6=

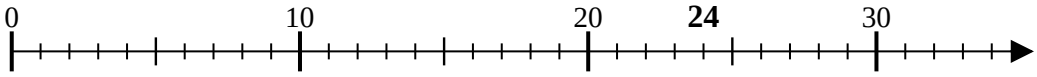

8) 45÷9=

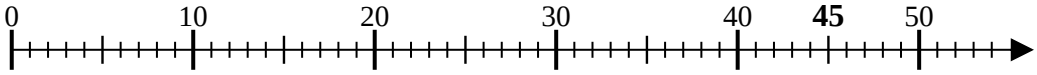

9) 50÷10=

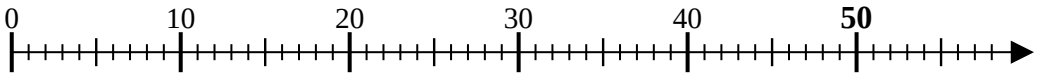

10) 4÷2=

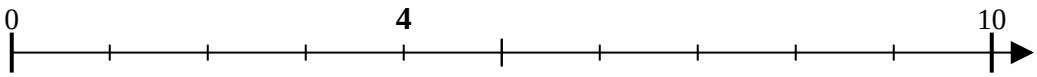

11) 35÷7=

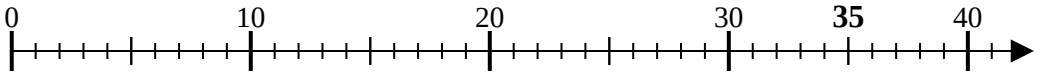

Réponses

1. _____
2. _____
3. _____
4. _____
5. _____
6. _____
7. _____
8. _____
9. _____
10. _____
11. _____

1-10	91	82	73	64	55	45	36	27	18	9
11	0									

Diviser avec une Droite Numérique Nom: **Clé**

Utilisez la droite numérique pour résoudre chaque problème.

1) 27÷9=

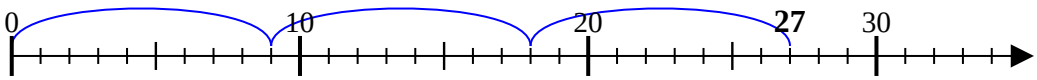

2) 18÷9=

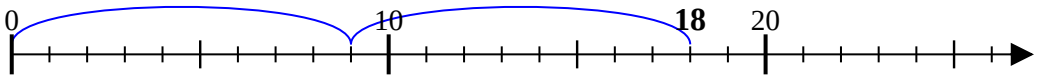

3) 32÷8=

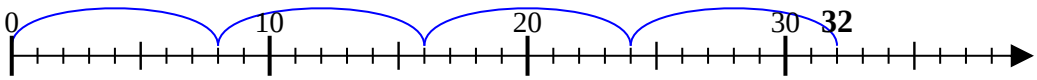

4) 8÷4=

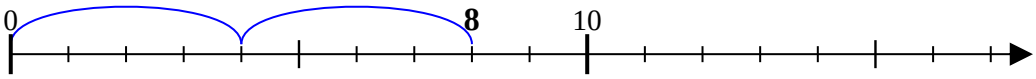

5) 40÷8=

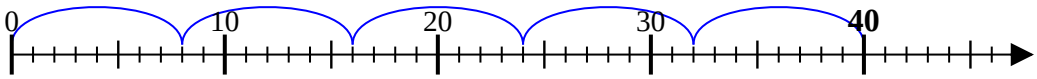

6) 15÷5=

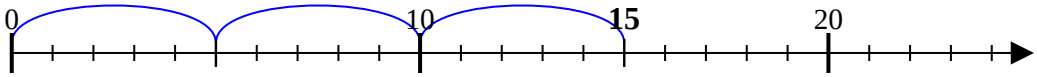

7) 24÷6=

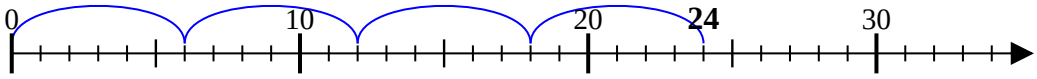

8) 45÷9=

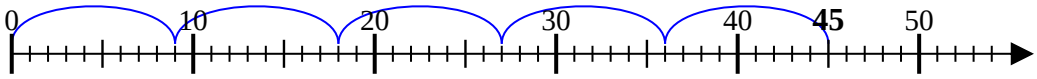

9) 50÷10=

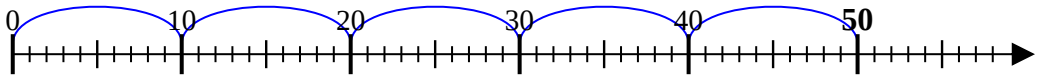

10) 4÷2=

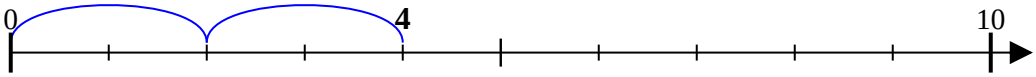

11) 35÷7=

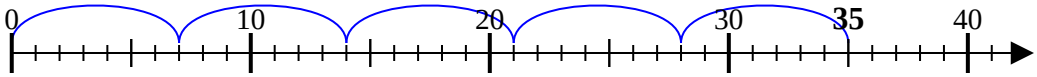

Réponses

1. 3
2. 2
3. 4
4. 2
5. 5
6. 3
7. 4
8. 5
9. 5
10. 2
11. 5

1-10	91	82	73	64	55	45	36	27	18	9
11	0									