Diviser avec une Droite Numérique

Nom:

Utilisez la droite numérique pour résoudre chaque problème.

1) 8÷4=

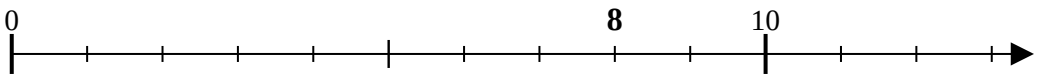

2) 10÷2=

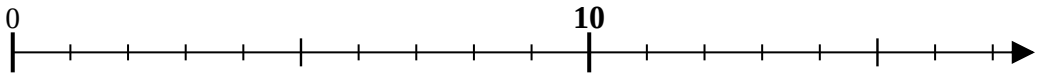

3) 24÷6=

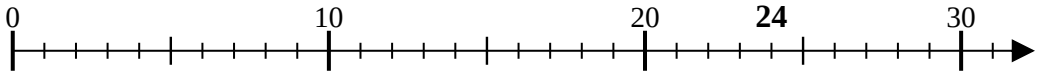

4) 16÷8=

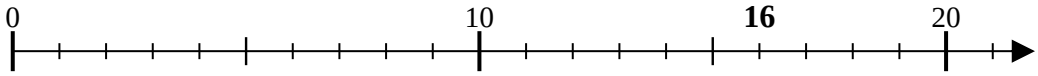

5) 12÷3=

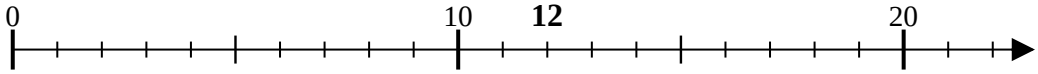

6) 20÷4=

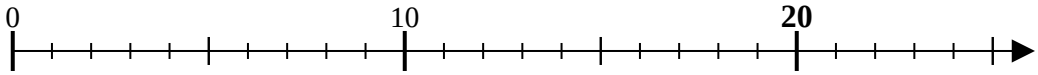

7) 30÷6=

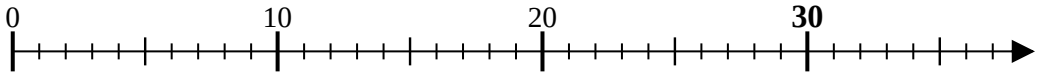

8) 27÷9=

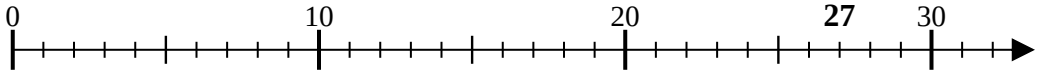

9) 35÷7=

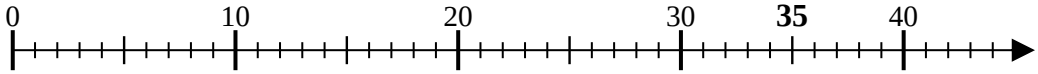

10) 14÷7=

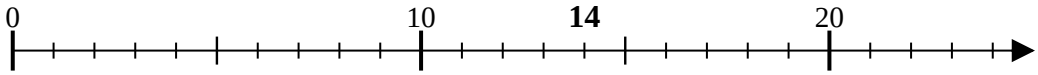

11) 16÷4=

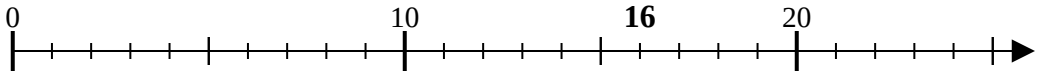

Réponses

1. _____
2. _____
3. _____
4. _____
5. _____
6. _____
7. _____
8. _____
9. _____
10. _____
11. _____

1-10	91	82	73	64	55	45	36	27	18	9
11	0									

Diviser avec une Droite Numérique Nom: **Clé**

Utilisez la droite numérique pour résoudre chaque problème.

1) 8÷4=

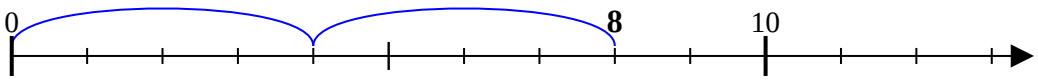

2) 10÷2=

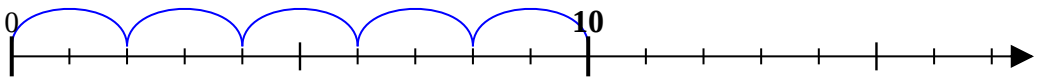

3) 24÷6=

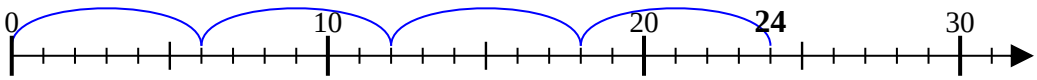

4) 16÷8=

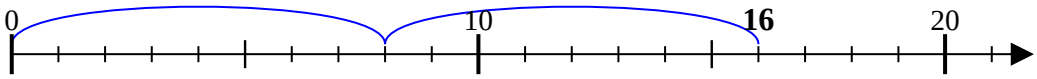

5) 12÷3=

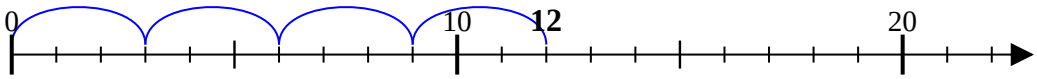

6) 20÷4=

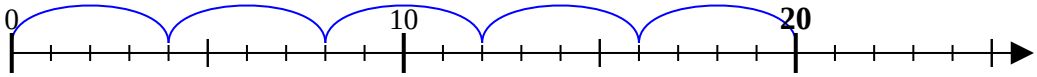

7) 30÷6=

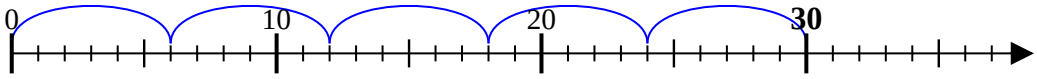

8) 27÷9=

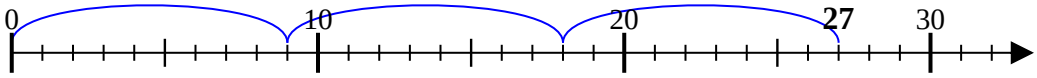

9) 35÷7=

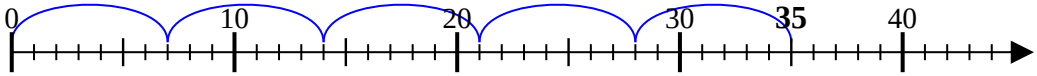

10) 14÷7=

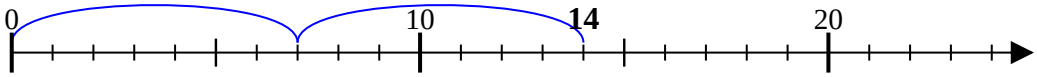

11) 16÷4=

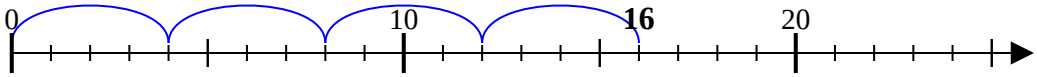

Réponses

1. 2
2. 5
3. 4
4. 2
5. 4
6. 5
7. 5
8. 3
9. 5
10. 2
11. 4