Diviser avec une Droite Numérique

Nom:

Utilisez la droite numérique pour résoudre chaque problème.

1) 18÷9=

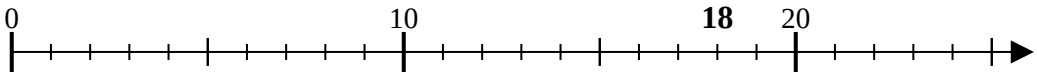

2) 15÷5=

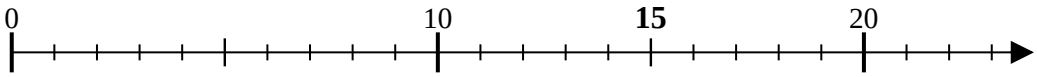

3) 8÷2=

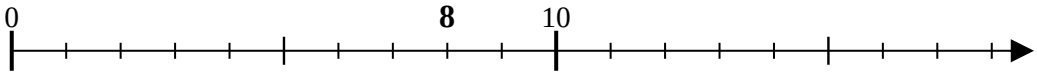

4) 16÷4=

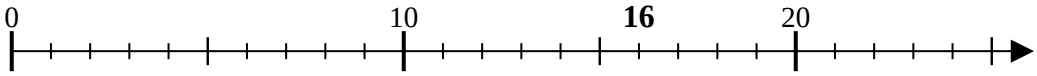

5) 40÷10=

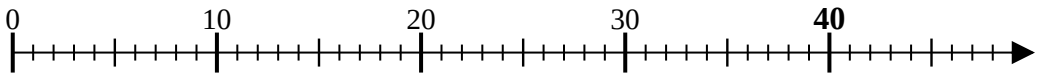

6) 4÷2=

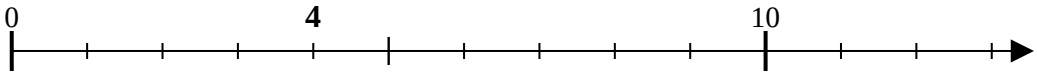

7) 45÷9=

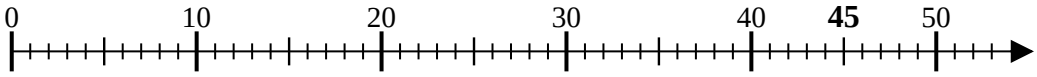

8) 15÷3=

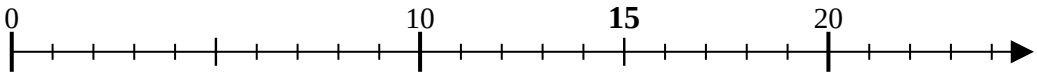

9) 28÷7=

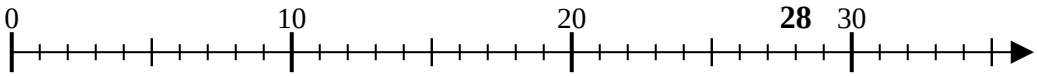

10) 16÷8=

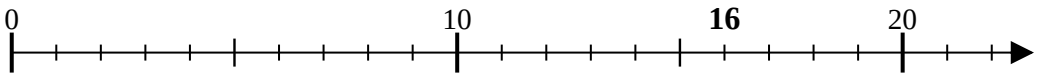

11) 8÷4=

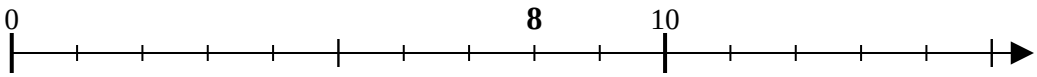

Réponses

1. _____
2. _____
3. _____
4. _____
5. _____
6. _____
7. _____
8. _____
9. _____
10. _____
11. _____

1-10	91	82	73	64	55	45	36	27	18	9
11	0									

Diviser avec une Droite Numérique Nom: **Clé**

Utilisez la droite numérique pour résoudre chaque problème.

1) 18÷9=

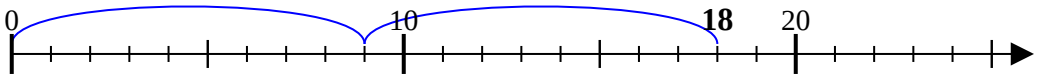

2) 15÷5=

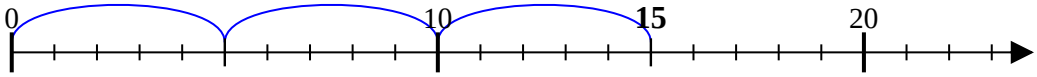

3) 8÷2=

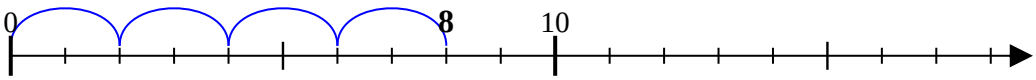

4) 16÷4=

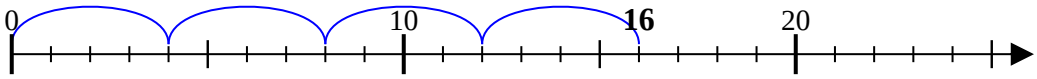

5) 40÷10=

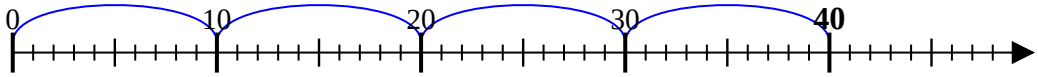

6) 4÷2=

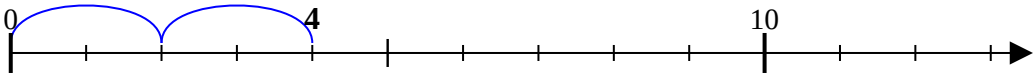

7) 45÷9=

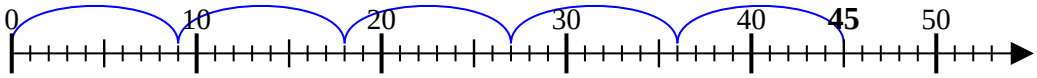

8) 15÷3=

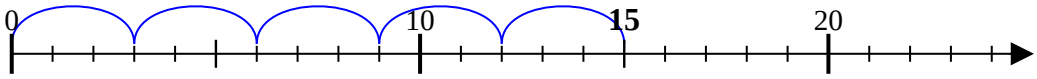

9) 28÷7=

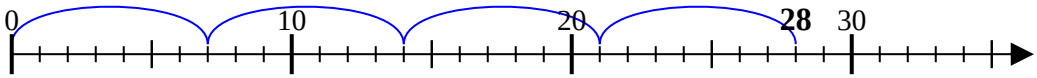

10) 16÷8=

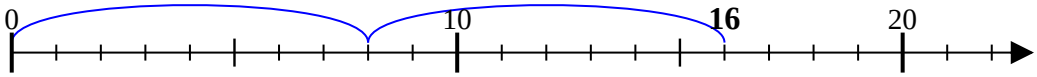

11) 8÷4=

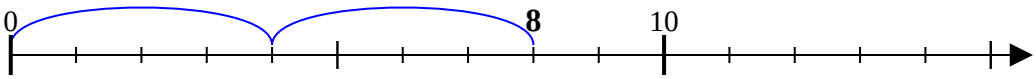

Réponses

1. 2
2. 3
3. 4
4. 4
5. 4
6. 2
7. 5
8. 5
9. 4
10. 2
11. 2

1-10	91	82	73	64	55	45	36	27	18	9
11	0									