Calculer la Distance sur un Quadrillage. Nom:

**Calculez la distance entre deux points. Arrondissez cotre réponse au 10ème.**

**Ex)**

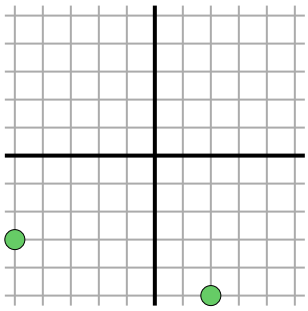

$\sqrt{(-5-2)^2 + (-3--5)^2}$

$\sqrt{(49) + (4)}$

**1)**

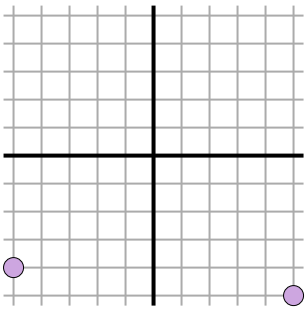

**2)**

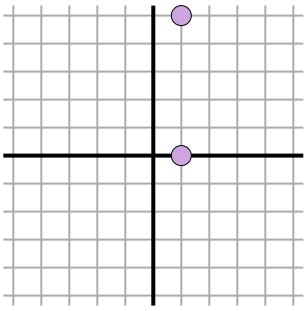

**3)**

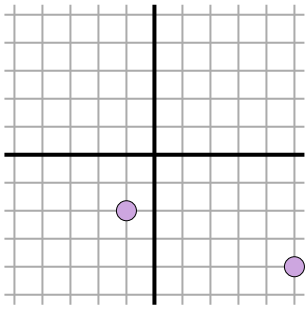

**4)**

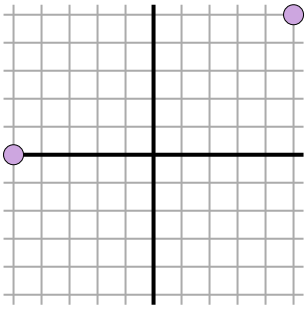

**5)**

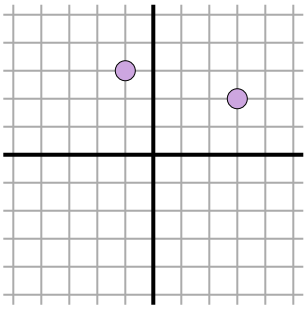

**6)**

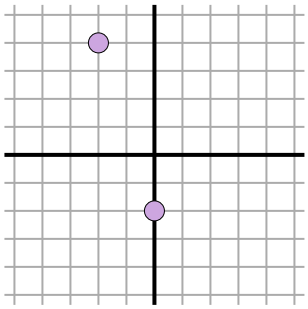

**7)**

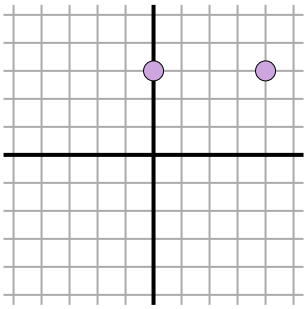

**8)**

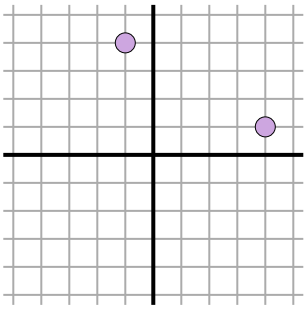

**9)**

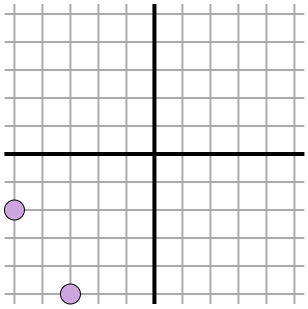

**10)**

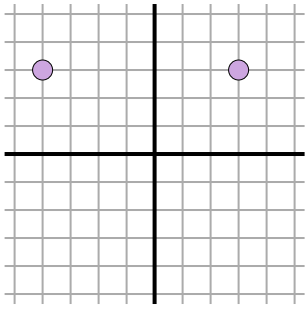

**11)**

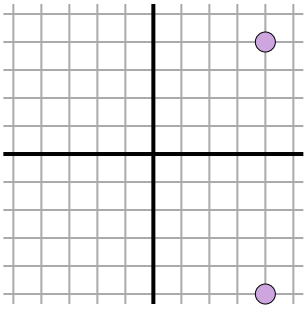

**Réponses**

Ex. 7.3

1. _____
2. _____
3. _____
4. _____
5. _____
6. _____
7. _____
8. _____
9. _____
10. _____
11. _____



| | | | | | | | | | | |
|---|---|---|---|---|---|---|---|---|---|---|
| 1-10 | 91 | 82 | 73 | 64 | 55 | 45 | 36 | 27 | 18 | 9 |
| 11 | 0 | | | | | | | | | |

Calculer la Distance sur un Quadrillage. Nom: **Clé**

**Calculez la distance entre deux points. Arrondissez cotre réponse au 10ème.**

**Ex)**

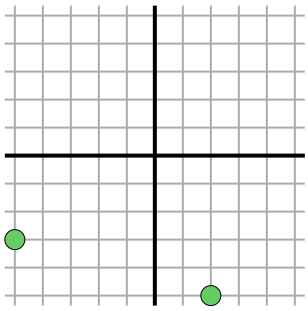

$\sqrt{(-5-2)^2 + (-3--5)^2}$

$\sqrt{(49) + (4)}$

**1)**

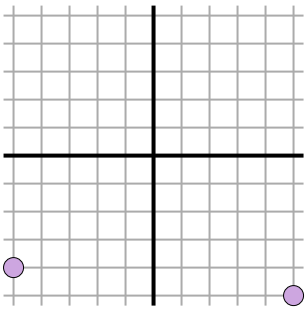

$\sqrt{(-5-5)^2 + (-4--5)^2}$

$\sqrt{(100) + (1)}$

**2)**

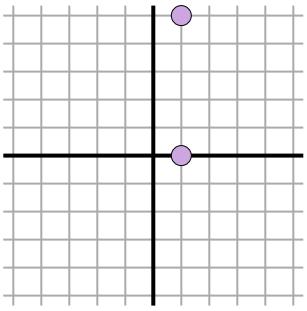

$\sqrt{(1-1)^2 + (5-0)^2}$

$\sqrt{(0) + (25)}$

**3)**

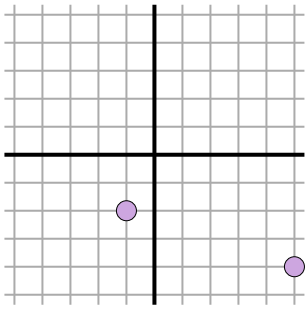

$\sqrt{(-1-5)^2 + (-2--4)^2}$

$\sqrt{(36) + (4)}$

**4)**

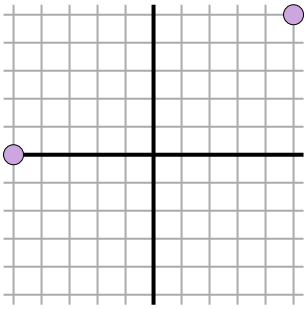

$\sqrt{(5--5)^2 + (5-0)^2}$

$\sqrt{(100) + (25)}$

**5)**

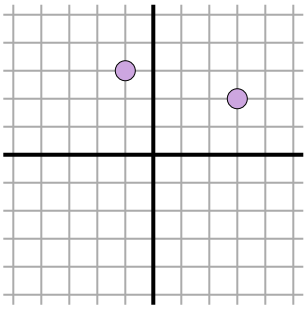

$\sqrt{(3--1)^2 + (2-3)^2}$

$\sqrt{(16) + (1)}$

**6)**

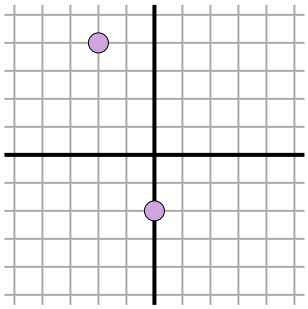

$\sqrt{(-2-0)^2 + (4--2)^2}$

$\sqrt{(4) + (36)}$

**7)**

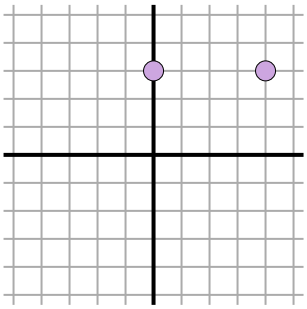

$\sqrt{(4-0)^2 + (3-3)^2}$

$\sqrt{(16) + (0)}$

**8)**

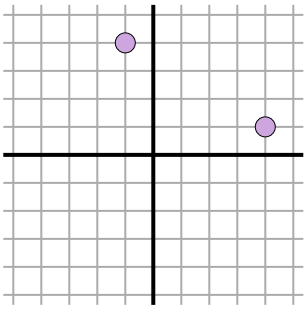

$\sqrt{(-1-4)^2 + (4-1)^2}$

$\sqrt{(25) + (9)}$

**9)**

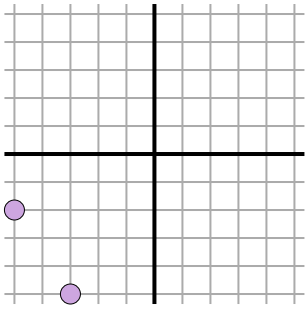

$\sqrt{(-5--3)^2 + (-2--5)^2}$

$\sqrt{(4) + (9)}$

**10)**

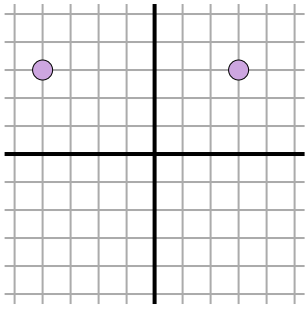

$\sqrt{(-4-3)^2 + (3-3)^2}$

$\sqrt{(49) + (0)}$

**11)**

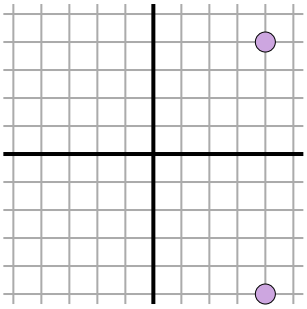

$\sqrt{(4-4)^2 + (-5-4)^2}$

$\sqrt{(0) + (81)}$

## Réponses

| | |
|---|---|
| Ex. | 7.3 |
| 1. | 10 |
| 2. | 5 |
| 3. | 6.3 |
| 4. | 11.2 |
| 5. | 4.1 |
| 6. | 6.3 |
| 7. | 4 |
| 8. | 5.8 |
| 9. | 3.6 |
| 10. | 7 |
| 11. | 9 |



| | | | | | | | | | | |
|---|---|---|---|---|---|---|---|---|---|---|
| 1-10 | 91 | 82 | 73 | 64 | 55 | 45 | 36 | 27 | 18 | 9 |
| 11 | 0 | | | | | | | | | |