Réécriture de Multiplication (Visuelle)

Nom:

Interpréter chaque figure en multiplication.

Ex) 

1)

2) 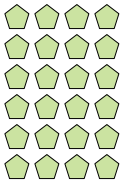

3) 

4)

5) 

6) 

7) 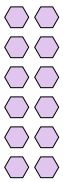

8) 

9) 

10) 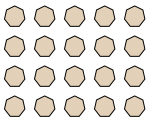

11) 

Réponses

Ex. 10 × 10 = 100

1. _____
2. _____
3. _____
4. _____
5. _____
6. _____
7. _____
8. _____
9. _____
10. _____
11. _____

Réécriture de Multiplication (Visuelle) Nom: **Clé**

Interpréter chaque figure en multiplication.

Ex) 

1)

2) 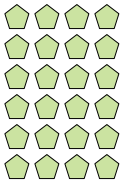

3) 

4)

5) 

6) 

7) 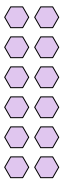

8)

9) 

10) 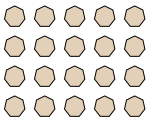

11) 

Réponses

Ex. 10 × 10 = 100

1. 2 × 2 = 4
2. 6 × 4 = 24
3. 4 × 8 = 32
4. 10 × 6 = 60
5. 9 × 4 = 36
6. 6 × 9 = 54
7. 6 × 2 = 12
8. 2 × 8 = 16
9. 10 × 7 = 70
10. 4 × 5 = 20
11. 6 × 5 = 30

1-10	91	82	73	64	55	45	36	27	18	9
11	0									