Réécriture de Multiplication (Visuelle)

Nom:

Interpréter chaque figure en multiplication.

Ex) 

1) 

2)

3) 

4)

5)

6)

7) 

8)

9) 

10)

11) 

Réponses

Ex. 10 × 5 = 50

1. _____
2. _____
3. _____
4. _____
5. _____
6. _____
7. _____
8. _____
9. _____
10. _____
11. _____

1-10	91	82	73	64	55	45	36	27	18	9
11	0									

Réécriture de Multiplication (Visuelle) Nom: **Clé**

Interpréter chaque figure en multiplication.

Ex) 

1) 

2)

3) 

4)

5)

6)

7) 

8)

9) 

10)

11) 

Réponses

Ex. **10 × 5 = 50**

1. **4 × 8 = 32**
2. **3 × 4 = 12**
3. **8 × 10 = 80**
4. **4 × 6 = 24**
5. **3 × 5 = 15**
6. **6 × 3 = 18**
7. **7 × 7 = 49**
8. **5 × 5 = 25**
9. **7 × 8 = 56**
10. **5 × 3 = 15**
11. **10 × 4 = 40**

1-10	91	82	73	64	55	45	36	27	18	9
11	0									