Réécriture de Multiplication (Visuelle)

Nom:

Interpréter chaque figure en multiplication.

Ex) 

1) 

2)

3) 

4) 

5)

6)

7)

8)

9) 

10)

11) 

Réponses

Ex. 3 × 9 = 27

1. _____
2. _____
3. _____
4. _____
5. _____
6. _____
7. _____
8. _____
9. _____
10. _____
11. _____

1-10	91	82	73	64	55	45	36	27	18	9
11	0									

Réécriture de Multiplication (Visuelle) Nom: **Clé**

Interpréter chaque figure en multiplication.

Ex) 

1) 

2)

3) 

4) 

5)

6)

7)

8)

9) 

10)

11) 

Réponses

Ex. 3 × 9 = 27

1. 6 × 4 = 24
2. 4 × 8 = 32
3. 6 × 3 = 18
4. 7 × 8 = 56
5. 2 × 7 = 14
6. 4 × 5 = 20
7. 2 × 5 = 10
8. 10 × 2 = 20
9. 8 × 8 = 64
10. 4 × 4 = 16
11. 6 × 7 = 42

1-10	91	82	73	64	55	45	36	27	18	9
11	0									