Réécriture de Multiplication (Visuelle)

Nom:

Interpréter chaque figure en multiplication.

Ex) 

1) 

2)

3) 

4)

5)

6)

7)

8)

9) 

10)

11)

Réponses

Ex. 8 × 6 = 48

1. _____
2. _____
3. _____
4. _____
5. _____
6. _____
7. _____
8. _____
9. _____
10. _____
11. _____

1-10	91	82	73	64	55	45	36	27	18	9
11	0									

Réécriture de Multiplication (Visuelle) Nom: **Clé**

Interpréter chaque figure en multiplication.

Ex) 

1) 

2)

3) 

4)

5)

6)

7)

8)

9) 

10)

11)

Réponses

Ex. 8 × 6 = 48

1. 6 × 4 = 24
2. 6 × 7 = 42
3. 9 × 7 = 63
4. 3 × 10 = 30
5. 4 × 8 = 32
6. 2 × 8 = 16
7. 2 × 4 = 8
8. 4 × 7 = 28
9. 10 × 9 = 90
10. 3 × 7 = 21
11. 10 × 2 = 20

1-10	91	82	73	64	55	45	36	27	18	9
11	0									