Réécriture de Multiplication (Visuelle)

Nom:

Interpréter chaque figure en multiplication.

Ex) 

1) 

2)

3) 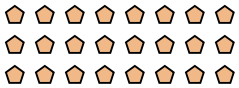

4) 

5)

6)

7) 

8)

9) 

10) 

11) 

Réponses

Ex. 10 × 6 = 60

1. _____
2. _____
3. _____
4. _____
5. _____
6. _____
7. _____
8. _____
9. _____
10. _____
11. _____

1-10	91	82	73	64	55	45	36	27	18	9
11	0									

Réécriture de Multiplication (Visuelle)

Nom: **Clé**

Interpréter chaque figure en multiplication.

Ex) 

1) 

2)

3) 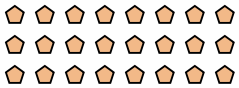

4) 

5)

6)

7) 

8)

9) 

10) 

11) 

Réponses

Ex. 10 × 6 = 60

1. 2 × 5 = 10
2. 2 × 4 = 8
3. 3 × 8 = 24
4. 6 × 5 = 30
5. 2 × 10 = 20
6. 10 × 3 = 30
7. 9 × 8 = 72
8. 3 × 3 = 9
9. 4 × 7 = 28
10. 9 × 4 = 36
11. 8 × 5 = 40

1-10	91	82	73	64	55	45	36	27	18	9
11	0									