Réécriture de Multiplication (Visuelle)

Nom:

Interpréter chaque figure en multiplication.

Ex) 

1) 

2)

3) 

4) 

5)

6) 

7)

8) 

9)

10)

11)

Réponses

Ex. 8 × 5 = 40

1. _____
2. _____
3. _____
4. _____
5. _____
6. _____
7. _____
8. _____
9. _____
10. _____
11. _____

1-10	91	82	73	64	55	45	36	27	18	9
11	0									

Réécriture de Multiplication (Visuelle)

Nom: **Clé**

Interpréter chaque figure en multiplication.

Ex) 

1) 

2)

3) 

4) 

5)

6) 

7)

8) 

9)

10)

11)

Réponses

Ex. 8 × 5 = 40

1. 4 × 2 = 8
2. 7 × 7 = 49
3. 7 × 6 = 42
4. 6 × 9 = 54
5. 7 × 3 = 21
6. 8 × 7 = 56
7. 4 × 6 = 24
8. 10 × 7 = 70
9. 3 × 7 = 21
10. 3 × 3 = 9
11. 8 × 4 = 32

1-10	91	82	73	64	55	45	36	27	18	9
11	0									