Réécriture de Multiplication (Visuelle)

Nom:

Interpréter chaque figure en multiplication.

Ex)



1)

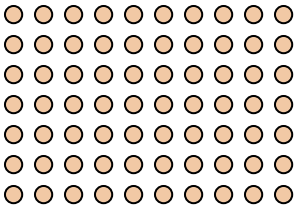

2)

3)

4)

5)



6)

7)

8)



9)



10)



11)



Réponses

Ex. 8 × 6 = 48

1. _____
2. _____
3. _____
4. _____
5. _____
6. _____
7. _____
8. _____
9. _____
10. _____
11. _____

1-10	91	82	73	64	55	45	36	27	18	9
11	0									

Réécriture de Multiplication (Visuelle)

Nom: **Clé**

Interpréter chaque figure en multiplication.

Ex) 

1) 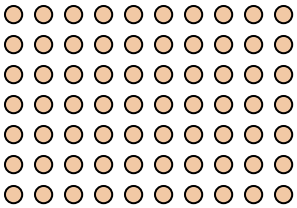

2)

3)

4)

5) 

6)

7)

8) 

9) 

10) 

11) 

Réponses

Ex. 8 × 6 = 48

1. 7 × 10 = 70
2. 3 × 9 = 27
3. 2 × 3 = 6
4. 2 × 10 = 20
5. 9 × 7 = 63
6. 2 × 5 = 10
7. 3 × 10 = 30
8. 10 × 10 = 100
9. 7 × 8 = 56
10. 4 × 5 = 20
11. 7 × 7 = 49

1-10	91	82	73	64	55	45	36	27	18	9
11	0									