Réécriture de Multiplication (Visuelle)

Nom:

Interpréter chaque figure en multiplication.

Ex) 

1) 

2) 

3) 

4)

5) 

6)

7)

8)

9)

10) 

11)

Réponses

Ex. 6 × 4 = 24

1. _____
2. _____
3. _____
4. _____
5. _____
6. _____
7. _____
8. _____
9. _____
10. _____
11. _____

1-10	91	82	73	64	55	45	36	27	18	9
11	0									

Réécriture de Multiplication (Visuelle)

Nom: **Clé**

Interpréter chaque figure en multiplication.

Ex) 

1) 

2) 

3) 

4)

5) 

6)

7)

8)

9)

10) 

11)

Réponses

Ex. 6 × 4 = 24

1. 9 × 7 = 63
2. 9 × 9 = 81
3. 9 × 5 = 45
4. 4 × 5 = 20
5. 10 × 7 = 70
6. 8 × 3 = 24
7. 7 × 4 = 28
8. 4 × 2 = 8
9. 9 × 3 = 27
10. 8 × 5 = 40
11. 3 × 2 = 6

1-10	91	82	73	64	55	45	36	27	18	9
11	0									