Multiplication avec Droites Numériques

Nom:

A l'aide de la droite numérique résoudre chaque problème.

1) 3 × 4 =
4 × 3 =

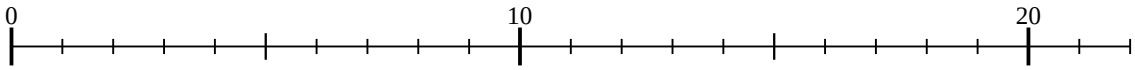

2) 5 × 3 =
3 × 5 =

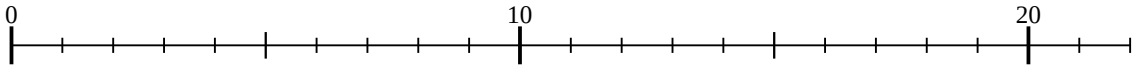

3) 4 × 4 =
4 × 4 =

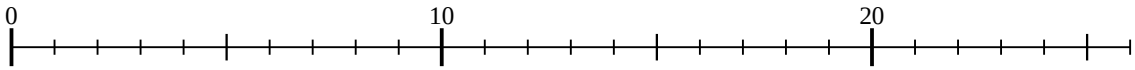

4) 2 × 4 =
4 × 2 =



5) 4 × 7 =
7 × 4 =

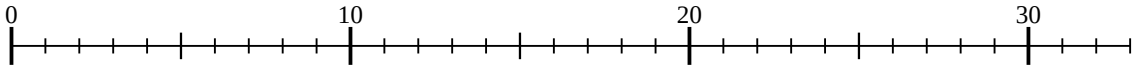

6) 4 × 8 =
8 × 4 =

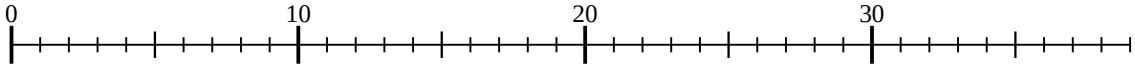

7) 5 × 5 =
5 × 5 =

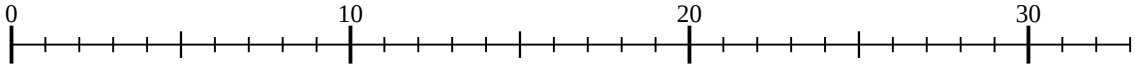

8) 2 × 10 =
10 × 2 =

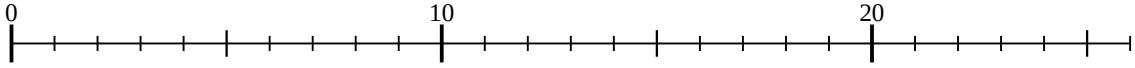

9) 3 × 6 =
6 × 3 =

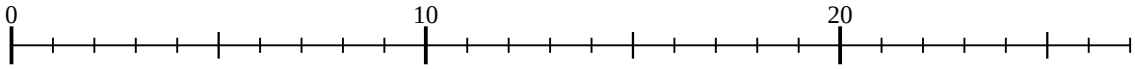

10) 5 × 10 =
10 × 5 =

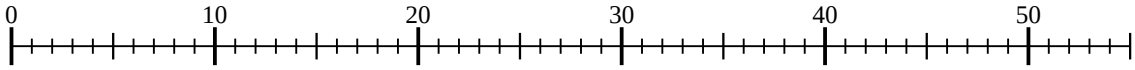

11) 4 × 3 =
3 × 4 =

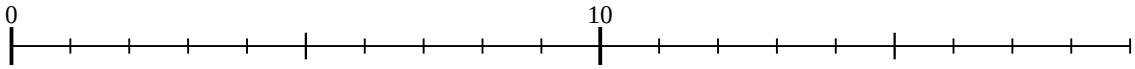

Réponses

1. _____
2. _____
3. _____
4. _____
5. _____
6. _____
7. _____
8. _____
9. _____
10. _____
11. _____

1-10	91	82	73	64	55	45	36	27	18	9
11	0									

Multiplication avec Droites Numériques

Nom: **Clé**

A l'aide de la droite numérique résoudre chaque problème.

1) 3 × 4 =
4 × 3 =

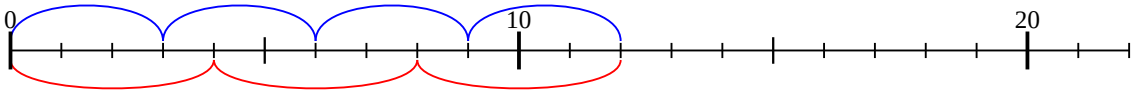

2) 5 × 3 =
3 × 5 =

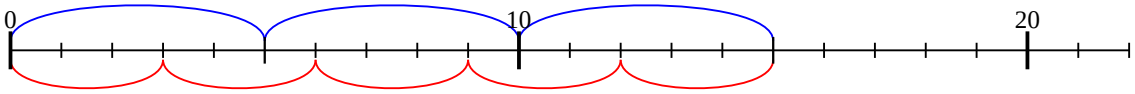

3) 4 × 4 =
4 × 4 =

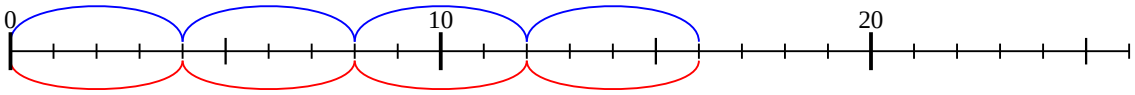

4) 2 × 4 =
4 × 2 =

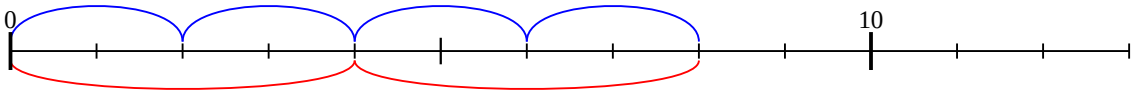

5) 4 × 7 =
7 × 4 =

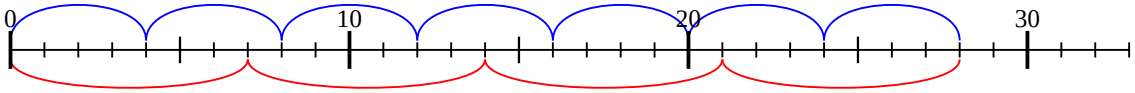

6) 4 × 8 =
8 × 4 =

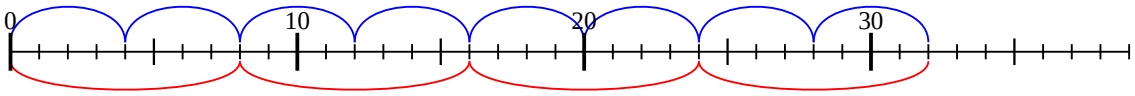

7) 5 × 5 =
5 × 5 =

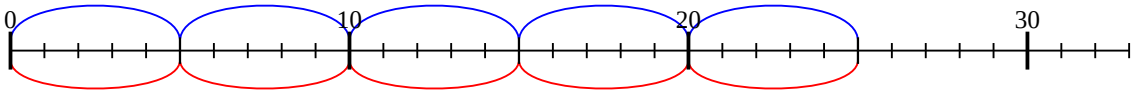

8) 2 × 10 =
10 × 2 =

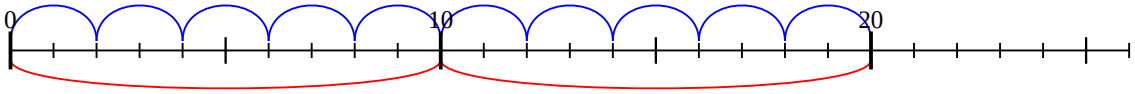

9) 3 × 6 =
6 × 3 =

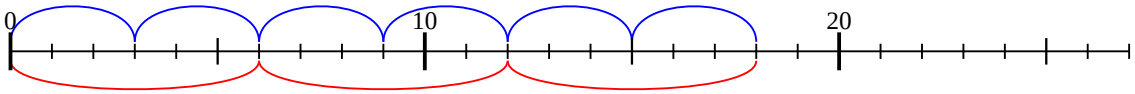

10) 5 × 10 =
10 × 5 =

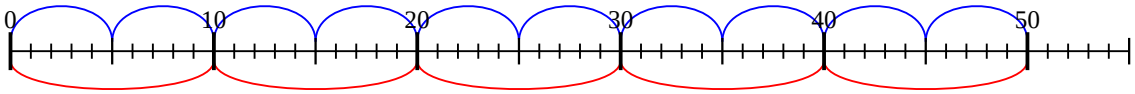

11) 4 × 3 =
3 × 4 =

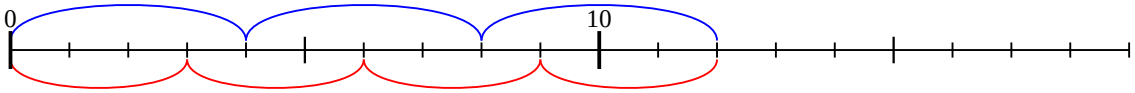

Réponses

1. **12**
2. **15**
3. **16**
4. **8**
5. **28**
6. **32**
7. **25**
8. **20**
9. **18**
10. **50**
11. **12**

1-10	91	82	73	64	55	45	36	27	18	9
11	0									