Multiplication avec Droites Numériques

Nom:

A l'aide de la droite numérique résoudre chaque problème.

1) 4 × 2 =
2 × 4 =

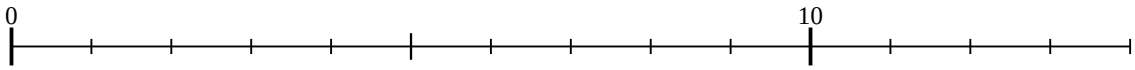

2) 5 × 5 =
5 × 5 =

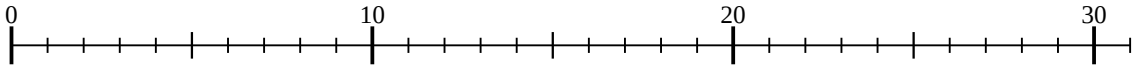

3) 5 × 10 =
10 × 5 =

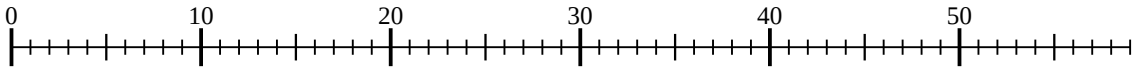

4) 5 × 2 =
2 × 5 =

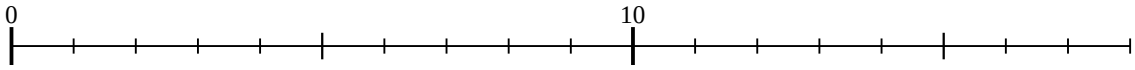

5) 5 × 6 =
6 × 5 =

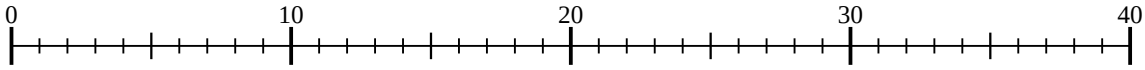

6) 2 × 2 =
2 × 2 =

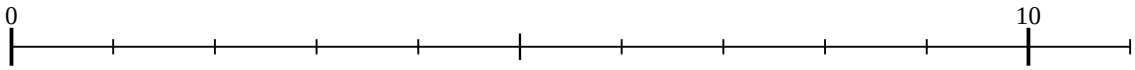

7) 2 × 8 =
8 × 2 =

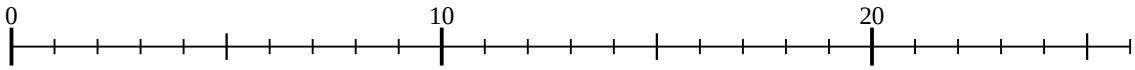

8) 4 × 5 =
5 × 4 =

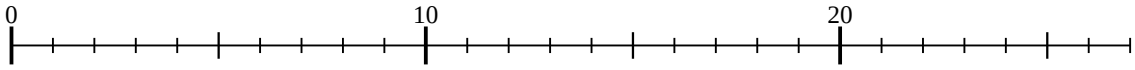

9) 3 × 6 =
6 × 3 =

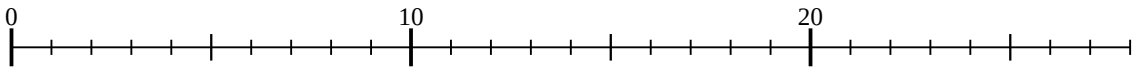

10) 2 × 6 =
6 × 2 =

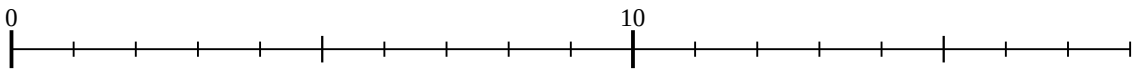

11) 2 × 4 =
4 × 2 =

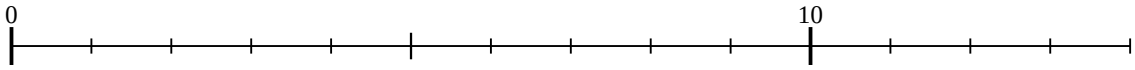

Réponses

1. _____
2. _____
3. _____
4. _____
5. _____
6. _____
7. _____
8. _____
9. _____
10. _____
11. _____

1-10	91	82	73	64	55	45	36	27	18	9
11	0									

Multiplication avec Droites Numériques

Nom: **Clé**

A l'aide de la droite numérique résoudre chaque problème.

1) 4 × 2 =
2 × 4 =

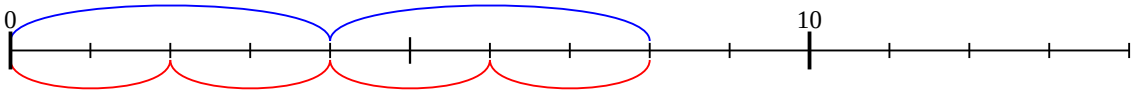

2) 5 × 5 =
5 × 5 =

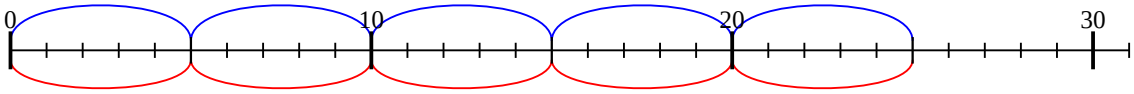

3) 5 × 10 =
10 × 5 =

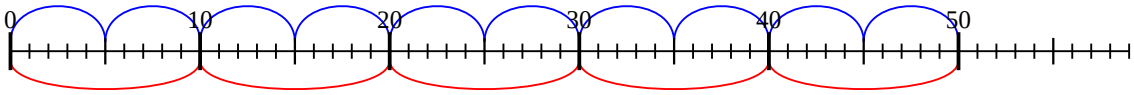

4) 5 × 2 =
2 × 5 =

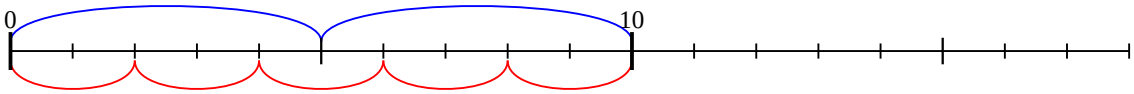

5) 5 × 6 =
6 × 5 =

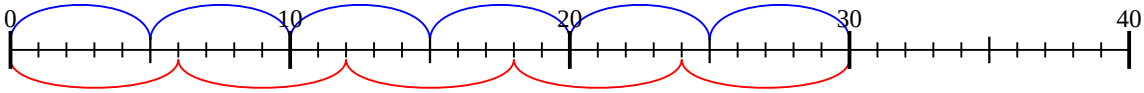

6) 2 × 2 =
2 × 2 =

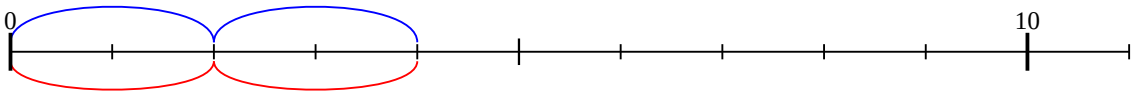

7) 2 × 8 =
8 × 2 =

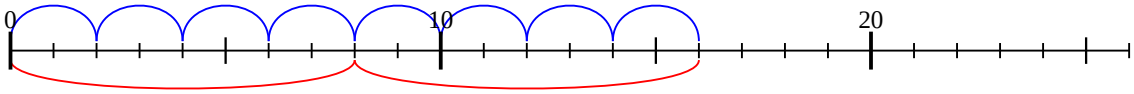

8) 4 × 5 =
5 × 4 =

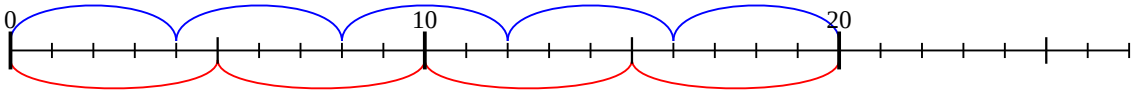

9) 3 × 6 =
6 × 3 =

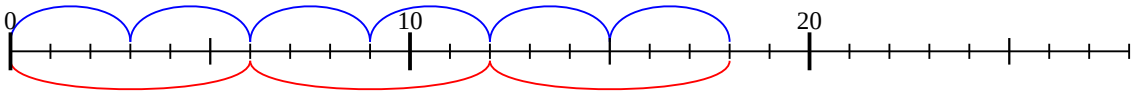

10) 2 × 6 =
6 × 2 =

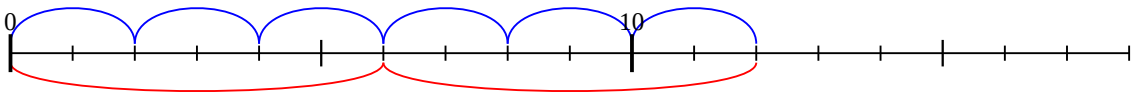

11) 2 × 4 =
4 × 2 =

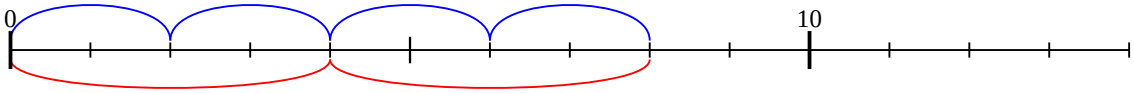

Réponses

1. **8**
2. **25**
3. **50**
4. **10**
5. **30**
6. **4**
7. **16**
8. **20**
9. **18**
10. **12**
11. **8**

1-10	91	82	73	64	55	45	36	27	18	9
11	0									