Multiplication avec Droites Numériques

Nom:

A l'aide de la droite numérique résoudre chaque problème.

1) 2 × 3 =
3 × 2 =

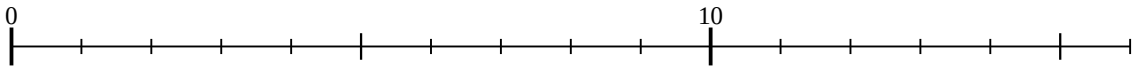

2) 4 × 6 =
6 × 4 =

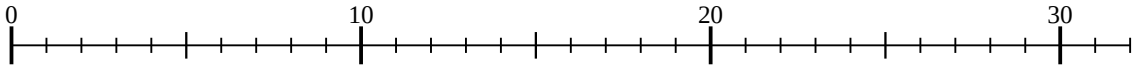

3) 5 × 2 =
2 × 5 =

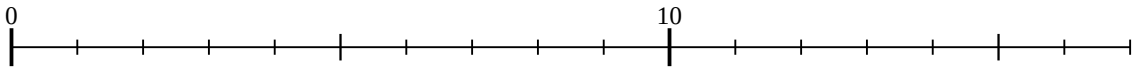

4) 4 × 7 =
7 × 4 =

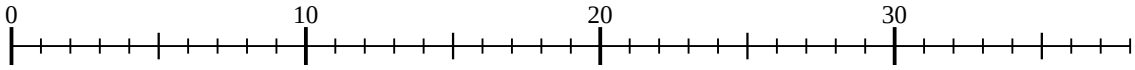

5) 3 × 10 =
10 × 3 =

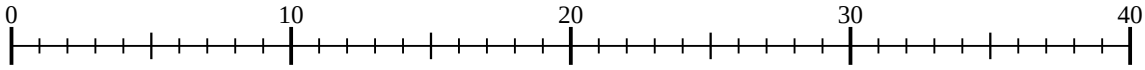

6) 3 × 7 =
7 × 3 =

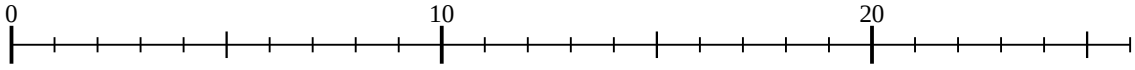

7) 3 × 3 =
3 × 3 =

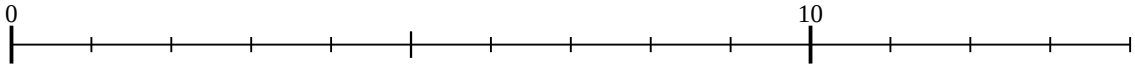

8) 2 × 8 =
8 × 2 =

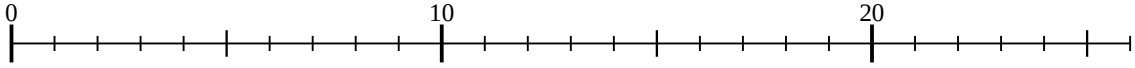

9) 5 × 7 =
7 × 5 =

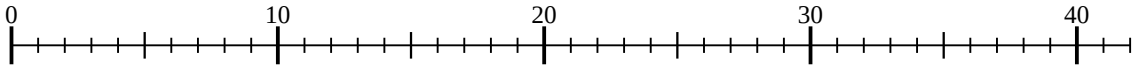

10) 4 × 10 =
10 × 4 =

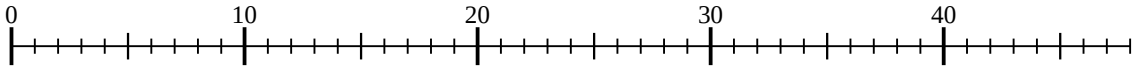

11) 4 × 4 =
4 × 4 =

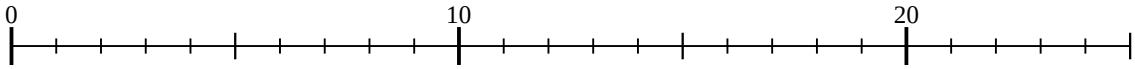

Réponses

1. _____
2. _____
3. _____
4. _____
5. _____
6. _____
7. _____
8. _____
9. _____
10. _____
11. _____

1-10	91	82	73	64	55	45	36	27	18	9
11	0									

Multiplication avec Droites Numériques

Nom: **Clé**

A l'aide de la droite numérique résoudre chaque problème.

1) 2 × 3 =
3 × 2 =

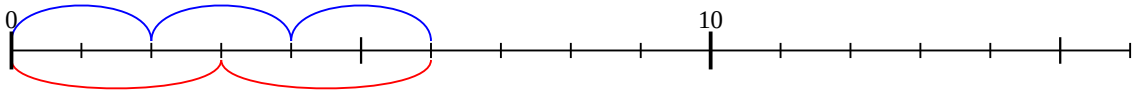

2) 4 × 6 =
6 × 4 =

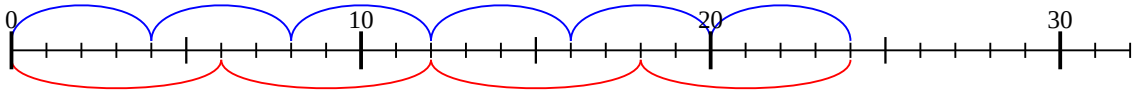

3) 5 × 2 =
2 × 5 =

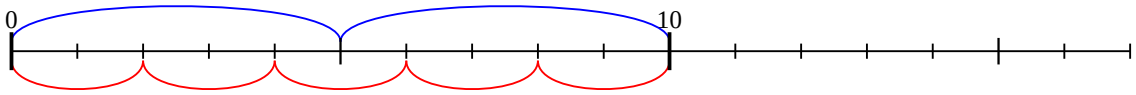

4) 4 × 7 =
7 × 4 =

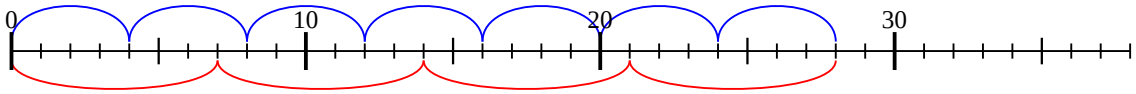

5) 3 × 10 =
10 × 3 =

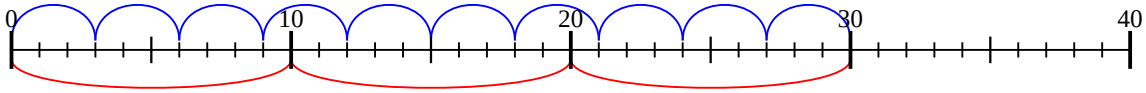

6) 3 × 7 =
7 × 3 =

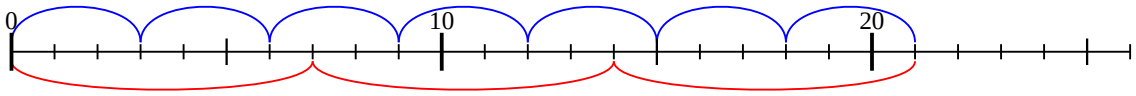

7) 3 × 3 =
3 × 3 =

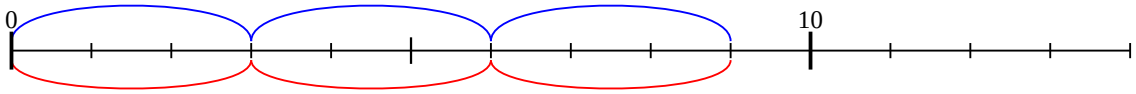

8) 2 × 8 =
8 × 2 =

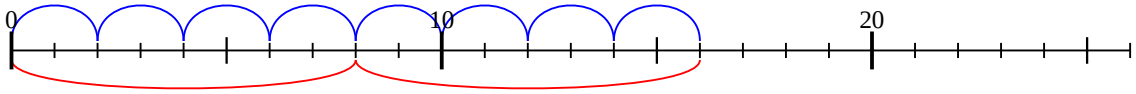

9) 5 × 7 =
7 × 5 =

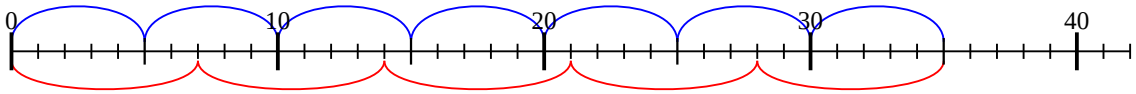

10) 4 × 10 =
10 × 4 =

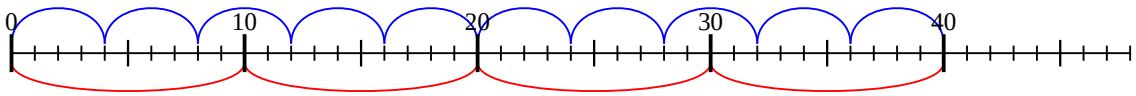

11) 4 × 4 =
4 × 4 =

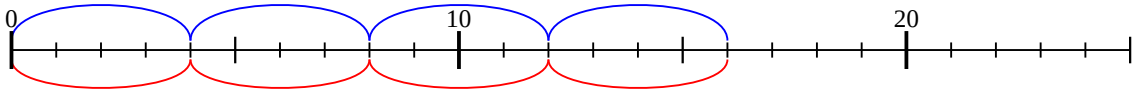

Réponses

1. **6**
2. **24**
3. **10**
4. **28**
5. **30**
6. **21**
7. **9**
8. **16**
9. **35**
10. **40**
11. **16**

1-10	91	82	73	64	55	45	36	27	18	9
11	0									