Diviser avec une Droite Numérique

Nom:

Utilisez la droite numérique pour résoudre chaque problème.

1) 6 ÷ 2 =



2) 9 ÷ 3 =

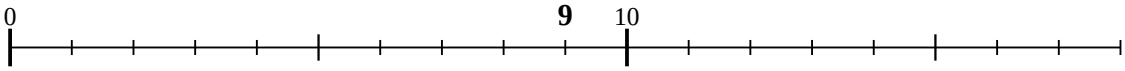

3) 8 ÷ 4 =

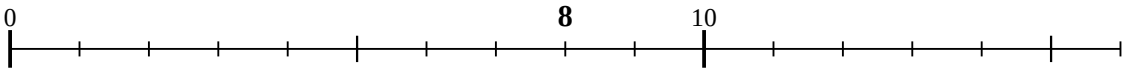

4) 27 ÷ 9 =

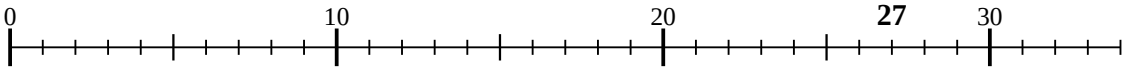

5) 12 ÷ 6 =

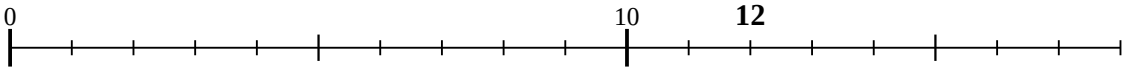

6) 15 ÷ 5 =

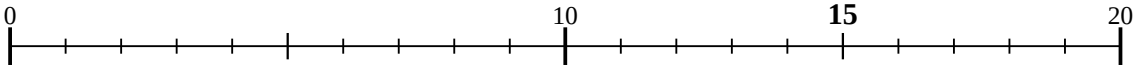

7) 20 ÷ 10 =

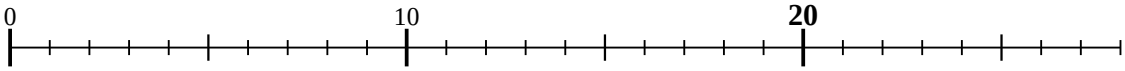

8) 25 ÷ 5 =

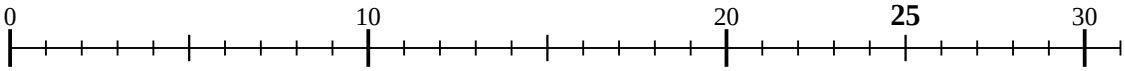

9) 12 ÷ 3 =

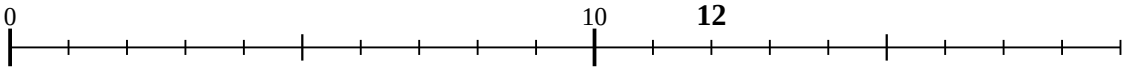

10) 16 ÷ 8 =

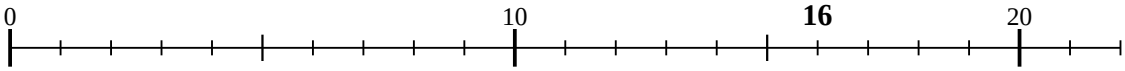

11) 36 ÷ 9 =

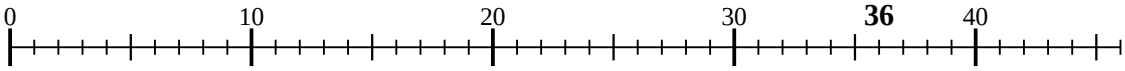

Réponses

1. _____
2. _____
3. _____
4. _____
5. _____
6. _____
7. _____
8. _____
9. _____
10. _____
11. _____

1-10	91	82	73	64	55	45	36	27	18	9
11	0									

Diviser avec une Droite Numérique

Nom: **Clé**

Utilisez la droite numérique pour résoudre chaque problème.

1) 6 ÷ 2 =

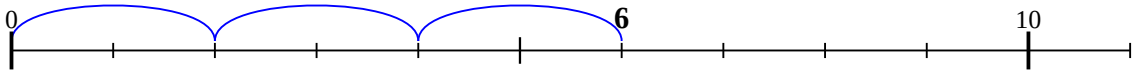

2) 9 ÷ 3 =

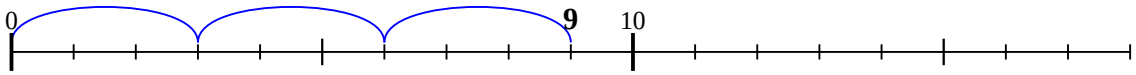

3) 8 ÷ 4 =

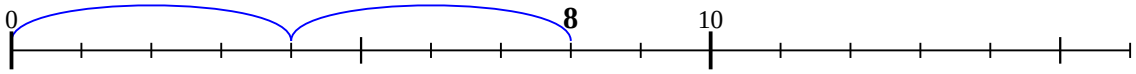

4) 27 ÷ 9 =

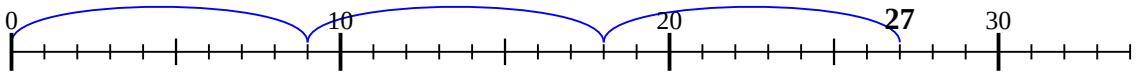

5) 12 ÷ 6 =

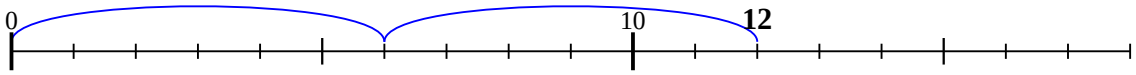

6) 15 ÷ 5 =

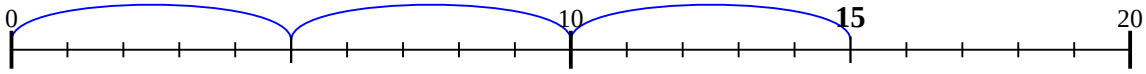

7) 20 ÷ 10 =

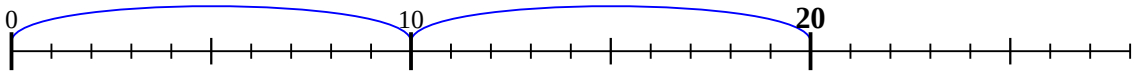

8) 25 ÷ 5 =

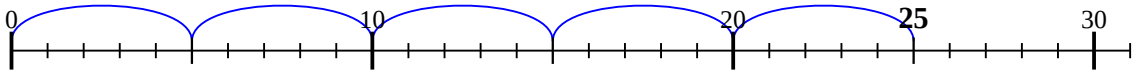

9) 12 ÷ 3 =

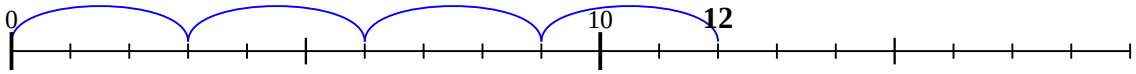

10) 16 ÷ 8 =

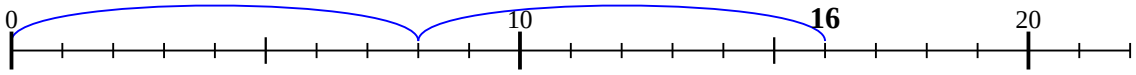

11) 36 ÷ 9 =

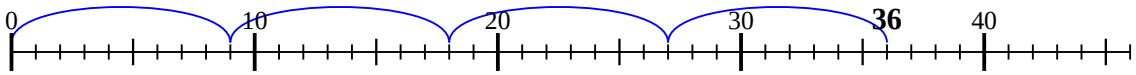

Réponses

1. **3**
2. **3**
3. **2**
4. **3**
5. **2**
6. **3**
7. **2**
8. **5**
9. **4**
10. **2**
11. **4**

1-10	91	82	73	64	55	45	36	27	18	9
11	0									