Diviser avec une Droite Numérique

Nom:

Utilisez la droite numérique pour résoudre chaque problème.

1) 12 ÷ 6 =

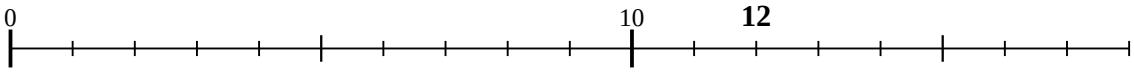

2) 28 ÷ 7 =

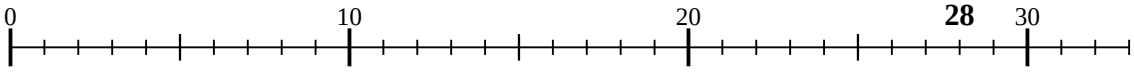

3) 10 ÷ 2 =

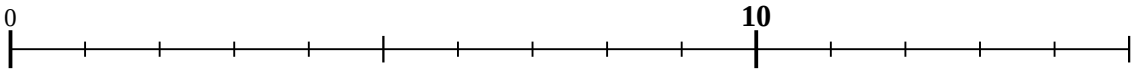

4) 16 ÷ 8 =

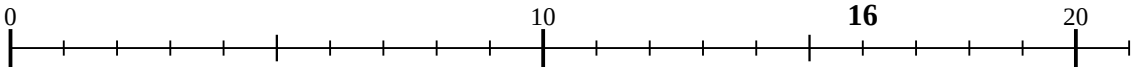

5) 35 ÷ 7 =

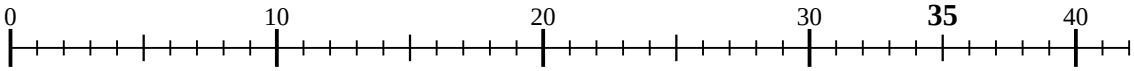

6) 8 ÷ 2 =



7) 40 ÷ 10 =

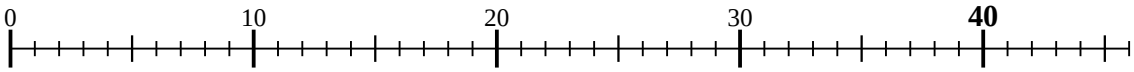

8) 30 ÷ 6 =

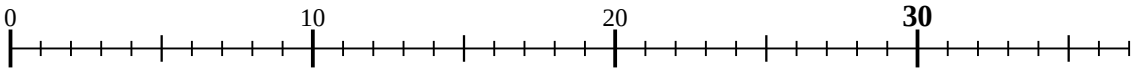

9) 30 ÷ 10 =

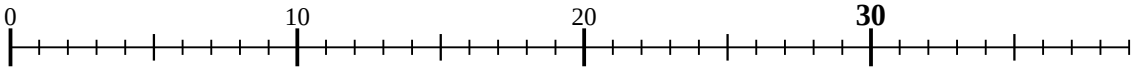

10) 14 ÷ 7 =

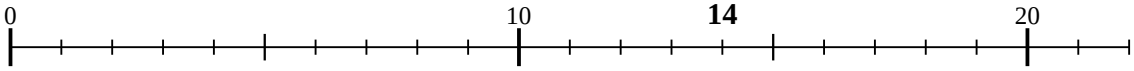

11) 10 ÷ 5 =

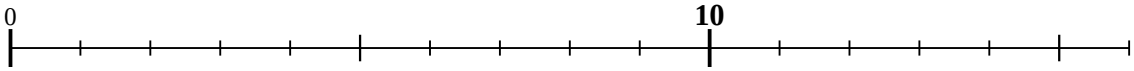

Réponses

1. _____
2. _____
3. _____
4. _____
5. _____
6. _____
7. _____
8. _____
9. _____
10. _____
11. _____

1-10	91	82	73	64	55	45	36	27	18	9
11	0									

Diviser avec une Droite Numérique

Nom: **Clé**

Utilisez la droite numérique pour résoudre chaque problème.

1) 12 ÷ 6 =

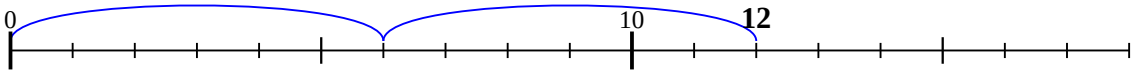

2) 28 ÷ 7 =

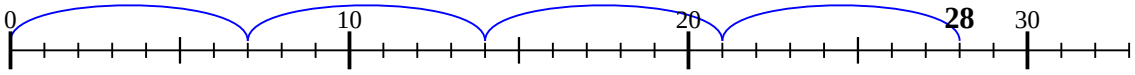

3) 10 ÷ 2 =

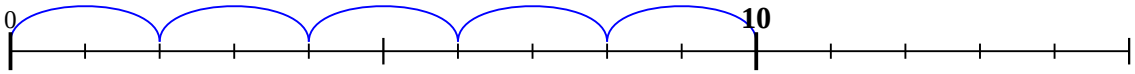

4) 16 ÷ 8 =

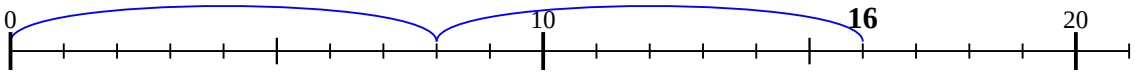

5) 35 ÷ 7 =

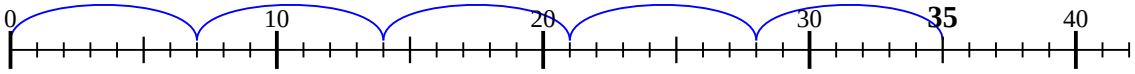

6) 8 ÷ 2 =

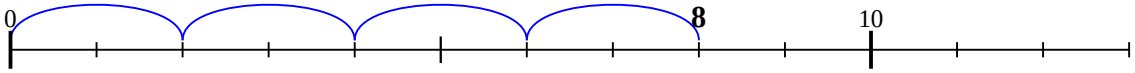

7) 40 ÷ 10 =

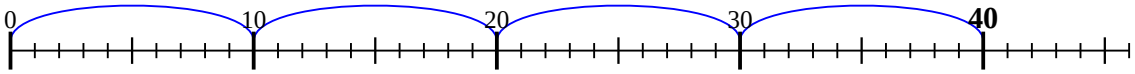

8) 30 ÷ 6 =

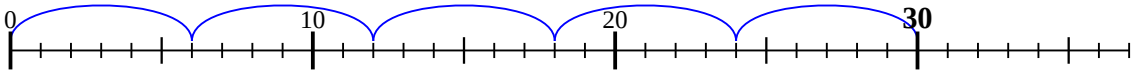

9) 30 ÷ 10 =

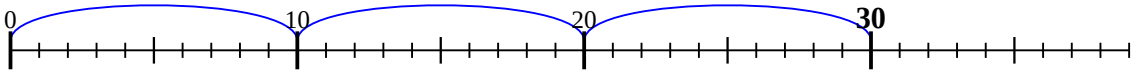

10) 14 ÷ 7 =

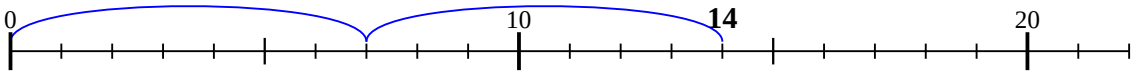

11) 10 ÷ 5 =

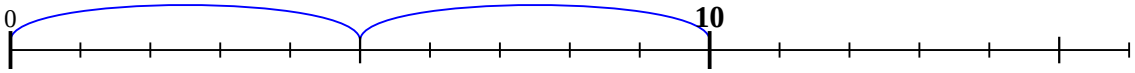

Réponses

1. **2**
2. **4**
3. **5**
4. **2**
5. **5**
6. **4**
7. **4**
8. **5**
9. **3**
10. **2**
11. **2**

1-10	91	82	73	64	55	45	36	27	18	9
11	0									