Diviser avec une Droite Numérique

Nom:

Utilisez la droite numérique pour résoudre chaque problème.

1) 21 ÷ 7 =

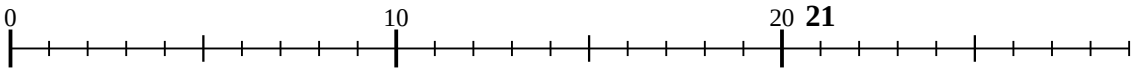

2) 10 ÷ 5 =

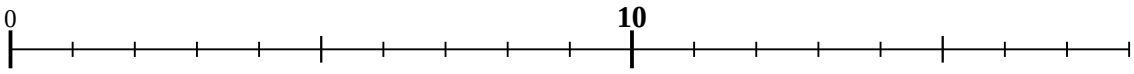

3) 15 ÷ 3 =

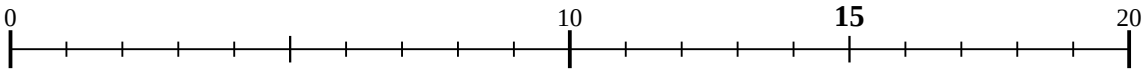

4) 9 ÷ 3 =

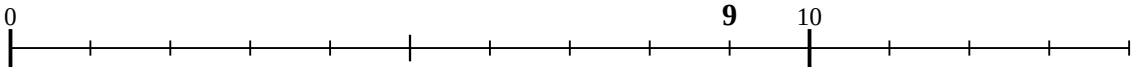

5) 20 ÷ 10 =

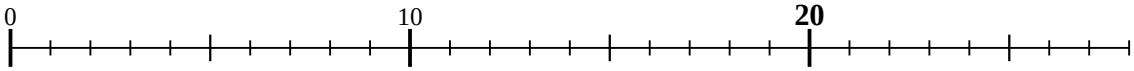

6) 27 ÷ 9 =

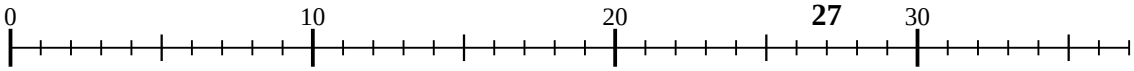

7) 24 ÷ 6 =

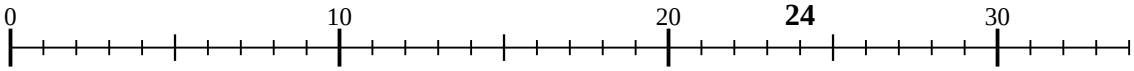

8) 36 ÷ 9 =

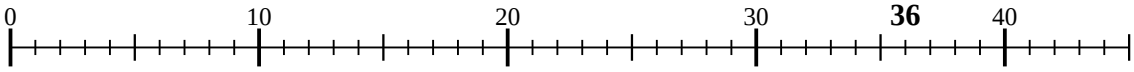

9) 35 ÷ 7 =

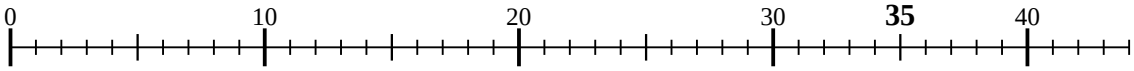

10) 50 ÷ 10 =

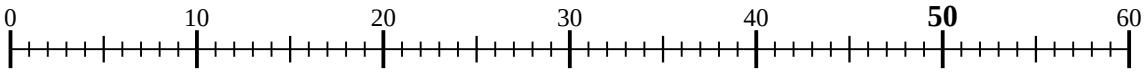

11) 8 ÷ 2 =

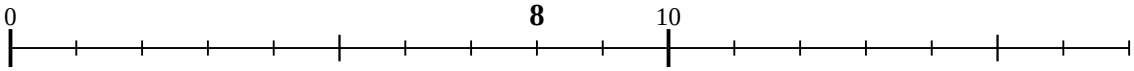

Réponses

1. _____
2. _____
3. _____
4. _____
5. _____
6. _____
7. _____
8. _____
9. _____
10. _____
11. _____

1-10	91	82	73	64	55	45	36	27	18	9
11	0									

Diviser avec une Droite Numérique

Nom: **Clé**

Utilisez la droite numérique pour résoudre chaque problème.

1) 21 ÷ 7 =

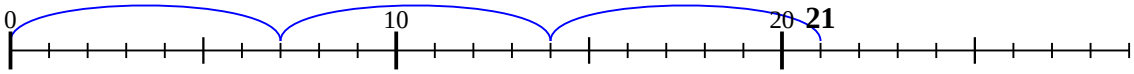

2) 10 ÷ 5 =

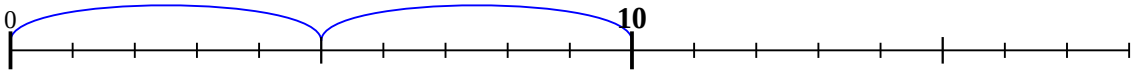

3) 15 ÷ 3 =

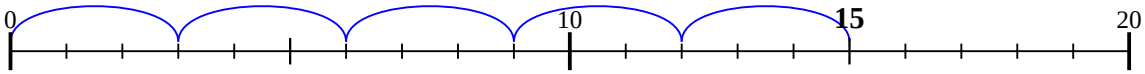

4) 9 ÷ 3 =

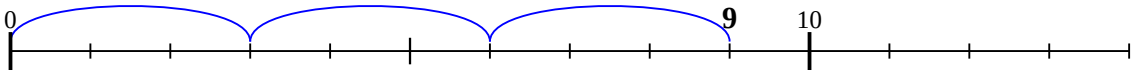

5) 20 ÷ 10 =

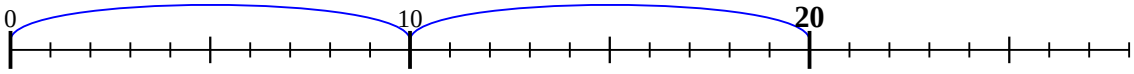

6) 27 ÷ 9 =

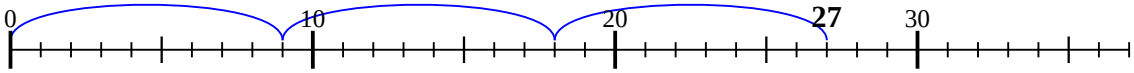

7) 24 ÷ 6 =

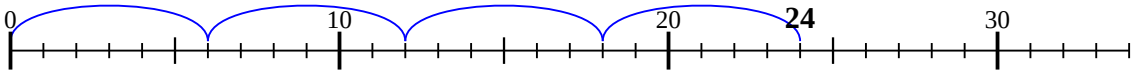

8) 36 ÷ 9 =

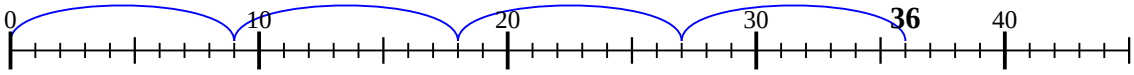

9) 35 ÷ 7 =

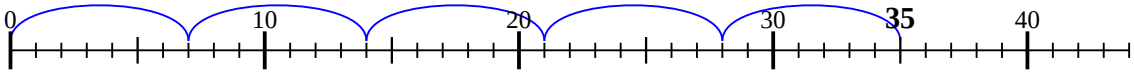

10) 50 ÷ 10 =

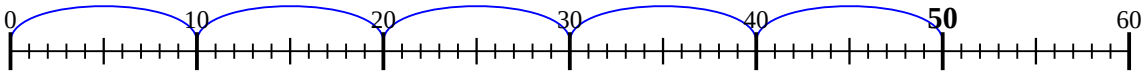

11) 8 ÷ 2 =

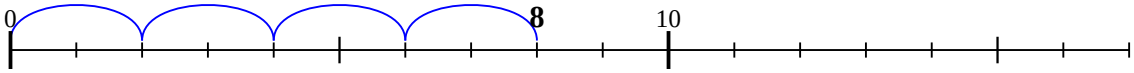

Réponses

1. **3**
2. **2**
3. **5**
4. **3**
5. **2**
6. **3**
7. **4**
8. **4**
9. **5**
10. **5**
11. **4**

1-10	91	82	73	64	55	45	36	27	18	9
11	0									