Diviser avec une Droite Numérique

Nom:

Utilisez la droite numérique pour résoudre chaque problème.

1) 12 ÷ 6 =

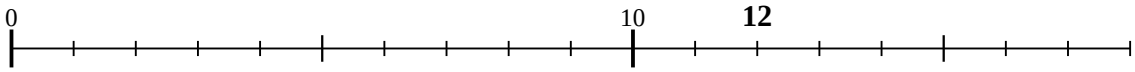

2) 32 ÷ 8 =

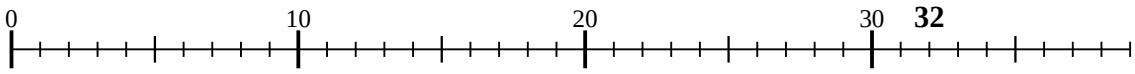

3) 18 ÷ 9 =

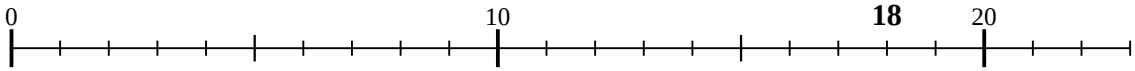

4) 25 ÷ 5 =

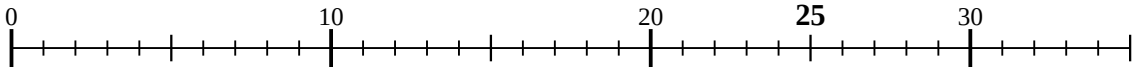

5) 14 ÷ 7 =

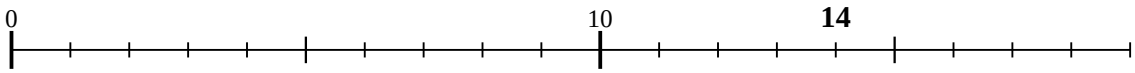

6) 16 ÷ 8 =

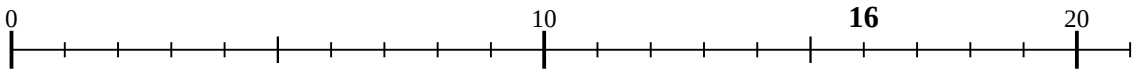

7) 20 ÷ 5 =

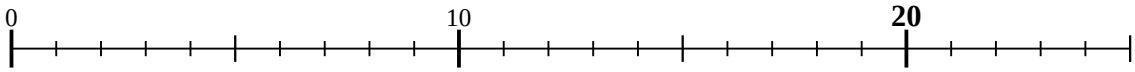

8) 8 ÷ 2 =



9) 12 ÷ 4 =

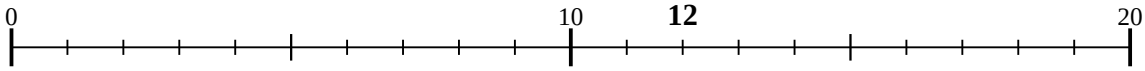

10) 40 ÷ 10 =

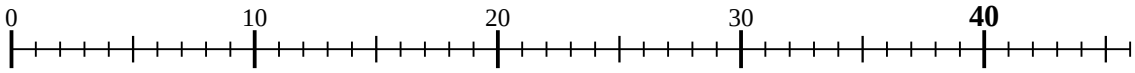

11) 45 ÷ 9 =

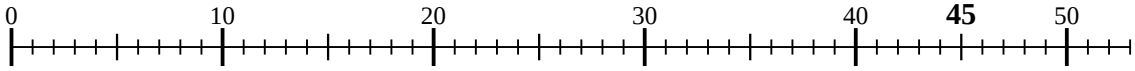

Réponses

1. _____
2. _____
3. _____
4. _____
5. _____
6. _____
7. _____
8. _____
9. _____
10. _____
11. _____

1-10	91	82	73	64	55	45	36	27	18	9
11	0									

Diviser avec une Droite Numérique

Nom: **Clé**

Utilisez la droite numérique pour résoudre chaque problème.

1) 12 ÷ 6 =

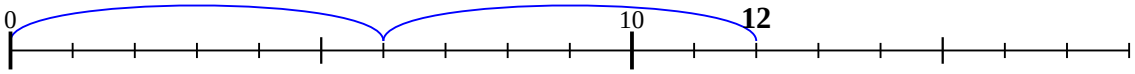

2) 32 ÷ 8 =

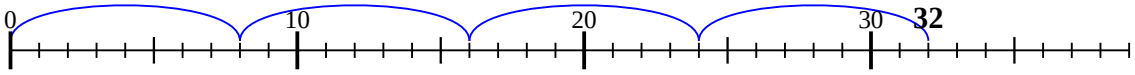

3) 18 ÷ 9 =

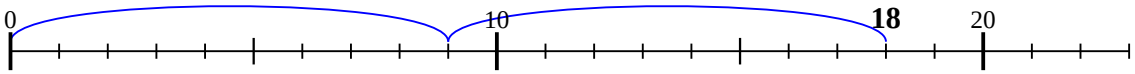

4) 25 ÷ 5 =

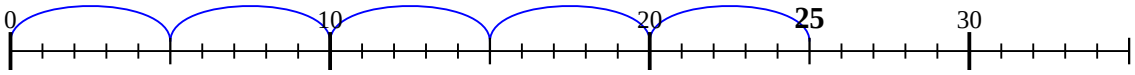

5) 14 ÷ 7 =

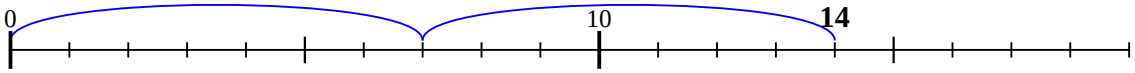

6) 16 ÷ 8 =

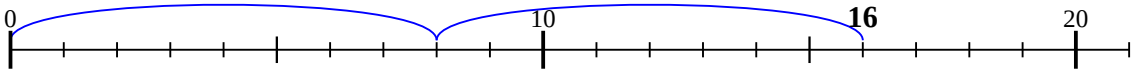

7) 20 ÷ 5 =

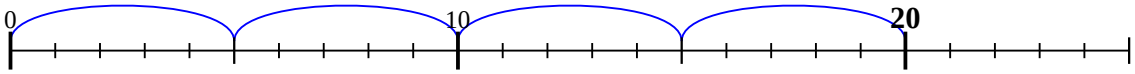

8) 8 ÷ 2 =

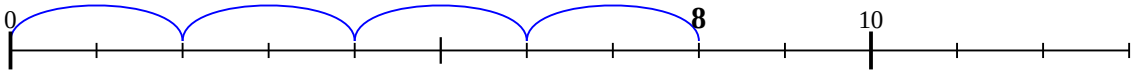

9) 12 ÷ 4 =

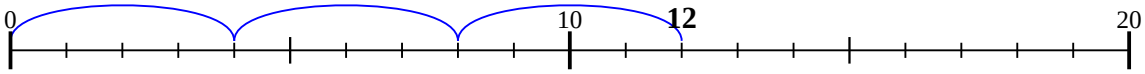

10) 40 ÷ 10 =

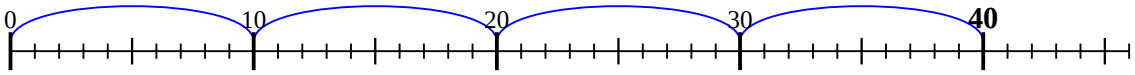

11) 45 ÷ 9 =

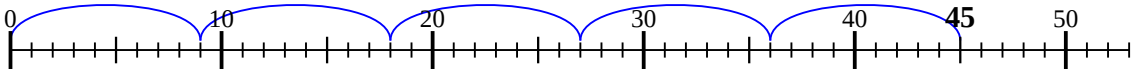

Réponses

1. **2**
2. **4**
3. **2**
4. **5**
5. **2**
6. **2**
7. **4**
8. **4**
9. **3**
10. **4**
11. **5**

1-10	91	82	73	64	55	45	36	27	18	9
11	0									