Diviser avec une Droite Numérique

Nom:

Utilisez la droite numérique pour résoudre chaque problème.

1) 20 ÷ 4 =

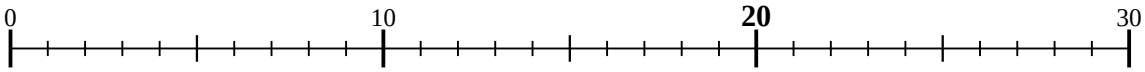

2) 4 ÷ 2 =

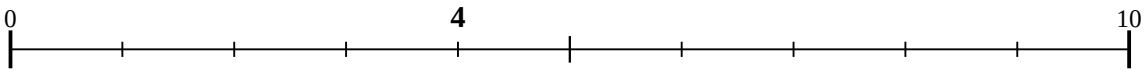

3) 40 ÷ 8 =

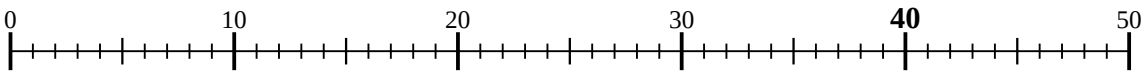

4) 24 ÷ 8 =

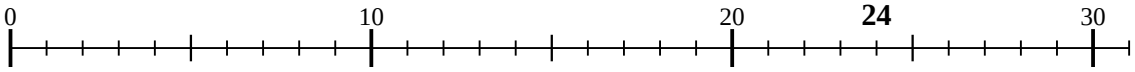

5) 36 ÷ 9 =

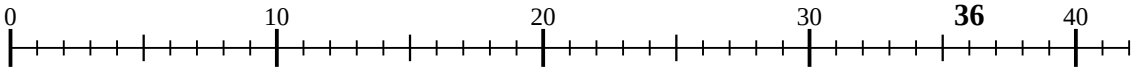

6) 45 ÷ 9 =

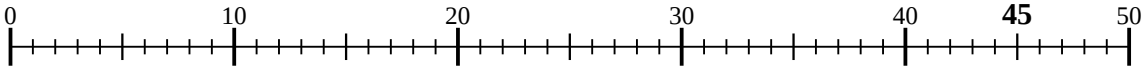

7) 28 ÷ 7 =

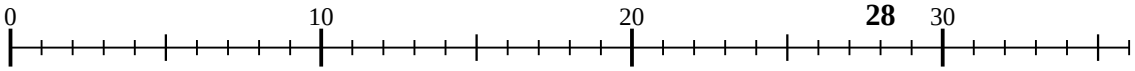

8) 12 ÷ 3 =

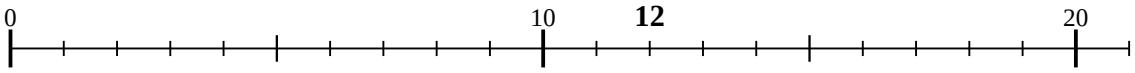

9) 12 ÷ 6 =

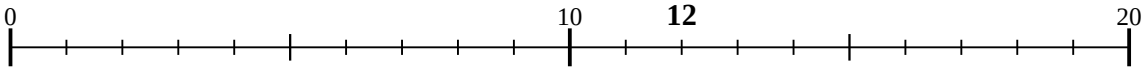

10) 9 ÷ 3 =

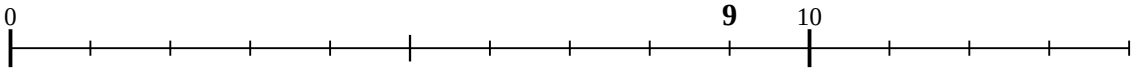

11) 16 ÷ 8 =

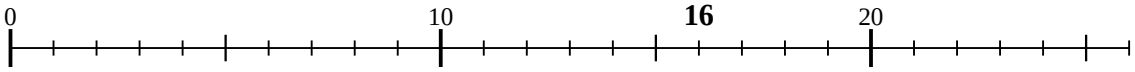

Réponses

1. _____
2. _____
3. _____
4. _____
5. _____
6. _____
7. _____
8. _____
9. _____
10. _____
11. _____

1-10	91	82	73	64	55	45	36	27	18	9
11	0									

Diviser avec une Droite Numérique

Nom: **Clé**

Utilisez la droite numérique pour résoudre chaque problème.

1) 20 ÷ 4 =

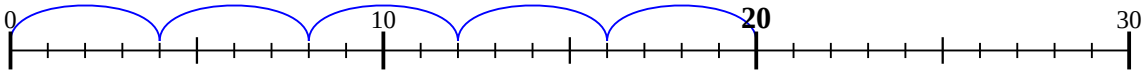

2) 4 ÷ 2 =

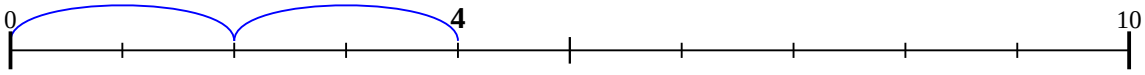

3) 40 ÷ 8 =

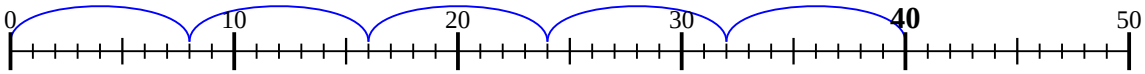

4) 24 ÷ 8 =

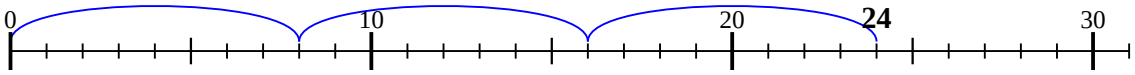

5) 36 ÷ 9 =

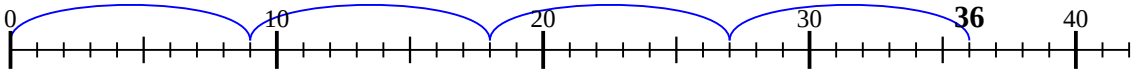

6) 45 ÷ 9 =

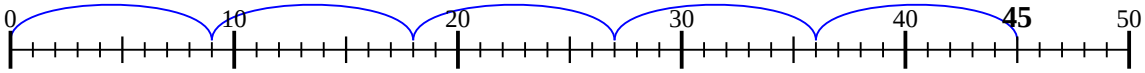

7) 28 ÷ 7 =

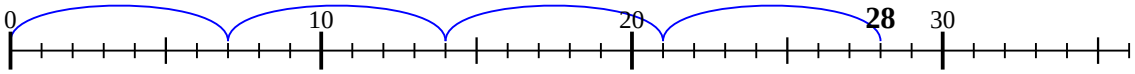

8) 12 ÷ 3 =

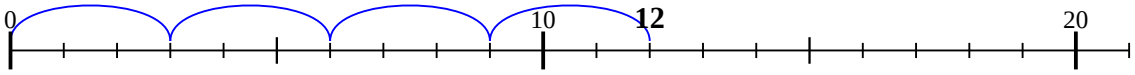

9) 12 ÷ 6 =

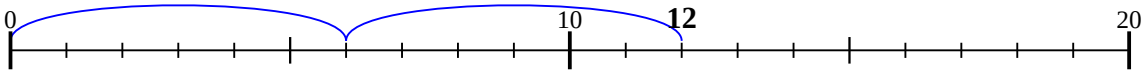

10) 9 ÷ 3 =

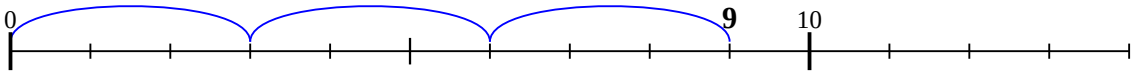

11) 16 ÷ 8 =

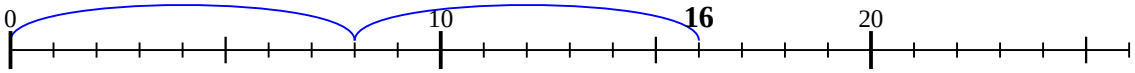

Réponses

1. 5
2. 2
3. 5
4. 3
5. 4
6. 5
7. 4
8. 4
9. 2
10. 3
11. 2

1-10	91	82	73	64	55	45	36	27	18	9
11	0									