Diviser avec une Droite Numérique

Nom:

Utilisez la droite numérique pour résoudre chaque problème.

1) 12 ÷ 3 =

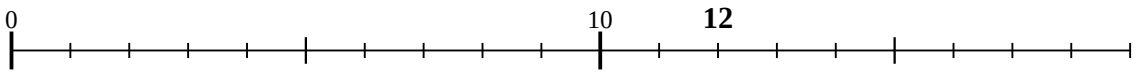

2) 45 ÷ 9 =

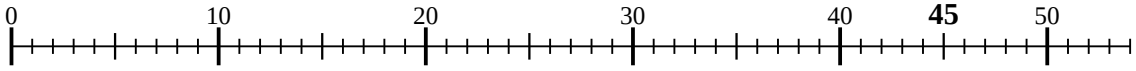

3) 18 ÷ 6 =

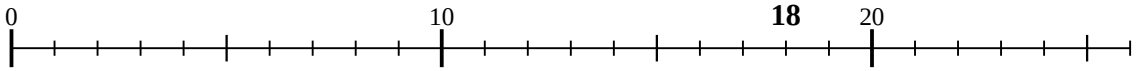

4) 10 ÷ 5 =

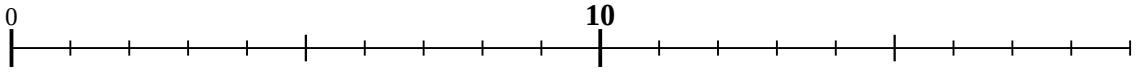

5) 9 ÷ 3 =

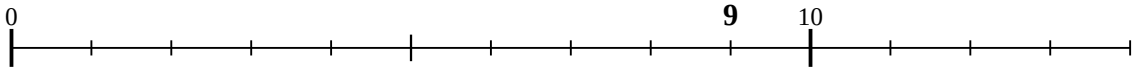

6) 50 ÷ 10 =

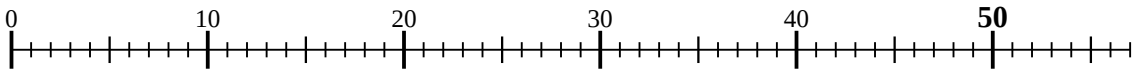

7) 16 ÷ 4 =

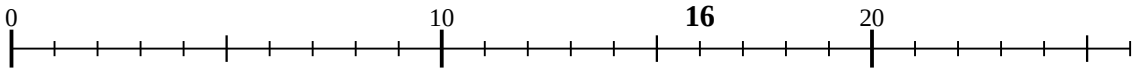

8) 6 ÷ 2 =

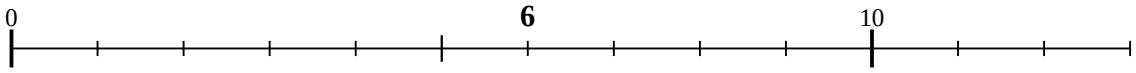

9) 15 ÷ 3 =

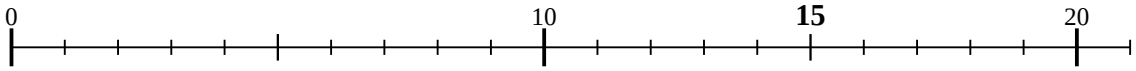

10) 20 ÷ 4 =

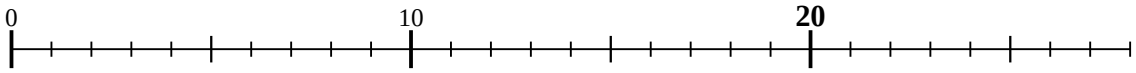

11) 35 ÷ 7 =

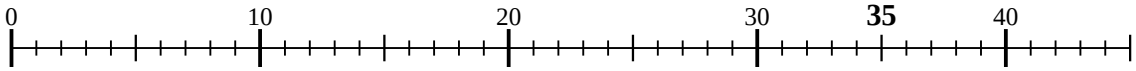

Réponses

1. _____
2. _____
3. _____
4. _____
5. _____
6. _____
7. _____
8. _____
9. _____
10. _____
11. _____

1-10	91	82	73	64	55	45	36	27	18	9
11	0									

Diviser avec une Droite Numérique

Nom: **Clé**

Utilisez la droite numérique pour résoudre chaque problème.

1) 12 ÷ 3 =

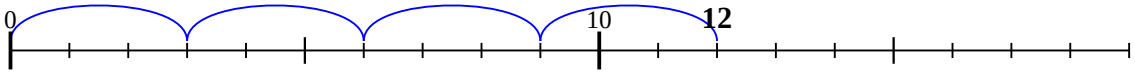

2) 45 ÷ 9 =

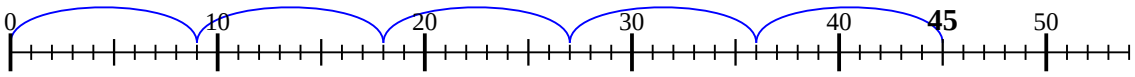

3) 18 ÷ 6 =

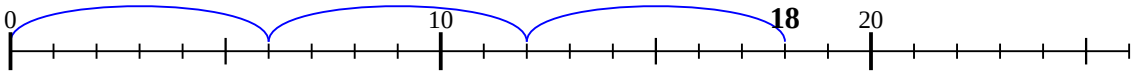

4) 10 ÷ 5 =

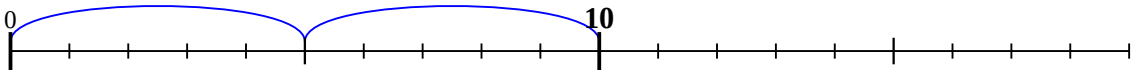

5) 9 ÷ 3 =

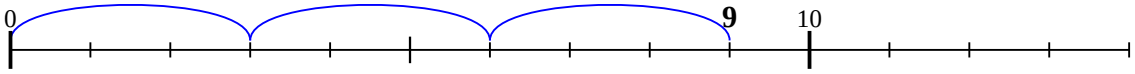

6) 50 ÷ 10 =

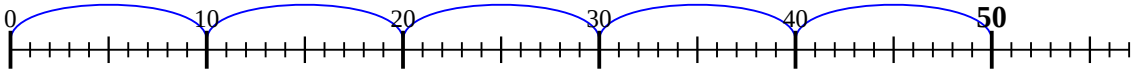

7) 16 ÷ 4 =

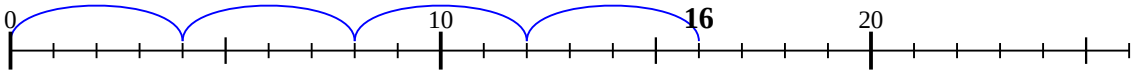

8) 6 ÷ 2 =



9) 15 ÷ 3 =

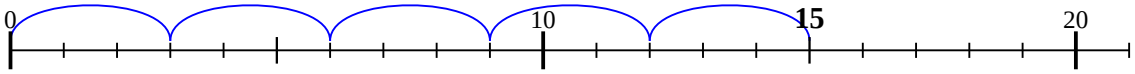

10) 20 ÷ 4 =

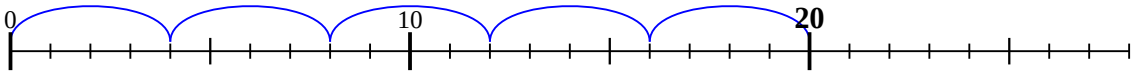

11) 35 ÷ 7 =

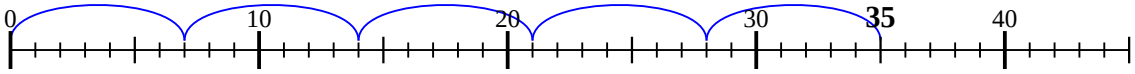

Réponses

1. **4**
2. **5**
3. **3**
4. **2**
5. **3**
6. **5**
7. **4**
8. **3**
9. **5**
10. **5**
11. **5**

1-10	91	82	73	64	55	45	36	27	18	9
11	0									