# Diviser avec une Droite Numérique

Nom:

**Utilisez la droite numérique pour résoudre chaque problème.**

**1)** 24 ÷ 6 =

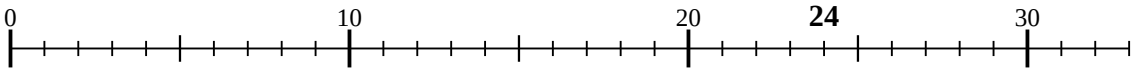


**2)** 8 ÷ 4 =

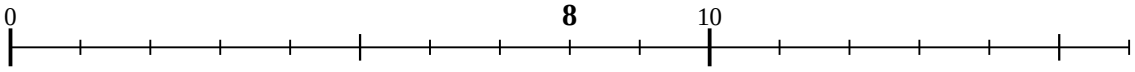


**3)** 40 ÷ 8 =

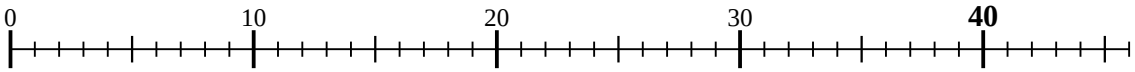


**4)** 20 ÷ 4 =

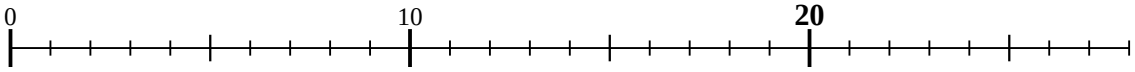


**5)** 28 ÷ 7 =

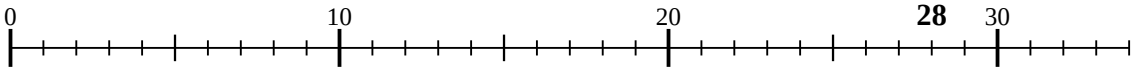


**6)** 9 ÷ 3 =

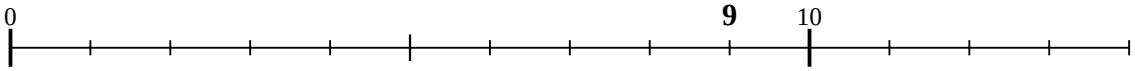


**7)** 25 ÷ 5 =

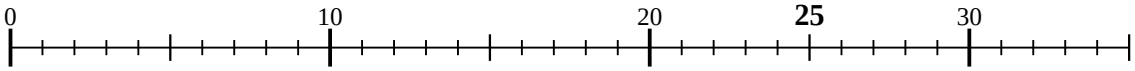


**8)** 20 ÷ 5 =

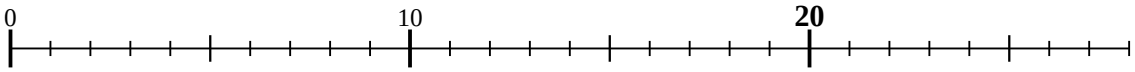


**9)** 32 ÷ 8 =

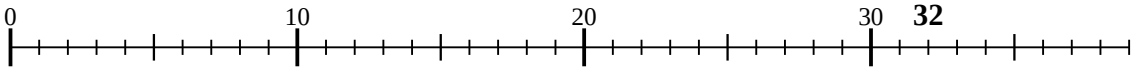


**10)** 6 ÷ 2 =

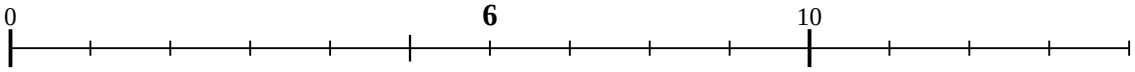


**11)** 12 ÷ 4 =

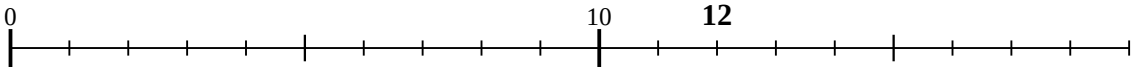


**Réponses**

1. _____
2. _____
3. _____
4. _____
5. _____
6. _____
7. _____
8. _____
9. _____
10. _____
11. _____



| | | | | | | | | | | |
|---|---|---|---|---|---|---|---|---|---|---|
| 1-10 | 91 | 82 | 73 | 64 | 55 | 45 | 36 | 27 | 18 | 9 |
| 11 | 0 | | | | | | | | | |

# Diviser avec une Droite Numérique

Nom: **Clé**

**Utilisez la droite numérique pour résoudre chaque problème.**

**1)** 24 ÷ 6 =

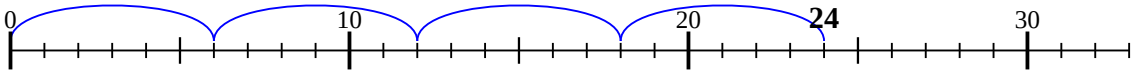


**2)** 8 ÷ 4 =

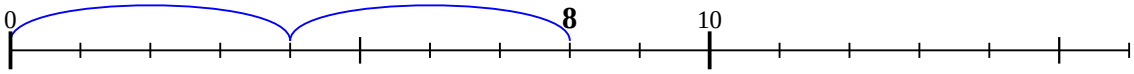


**3)** 40 ÷ 8 =

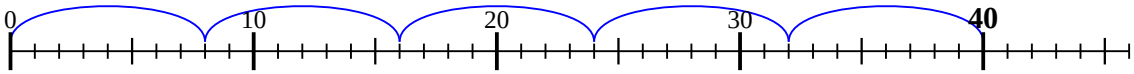


**4)** 20 ÷ 4 =

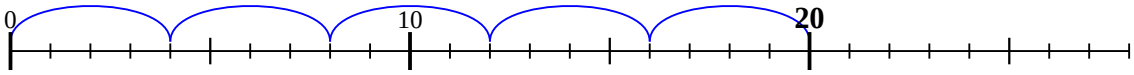


**5)** 28 ÷ 7 =

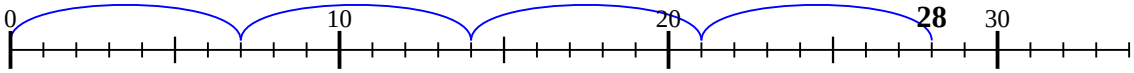


**6)** 9 ÷ 3 =

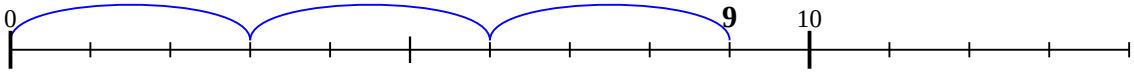


**7)** 25 ÷ 5 =

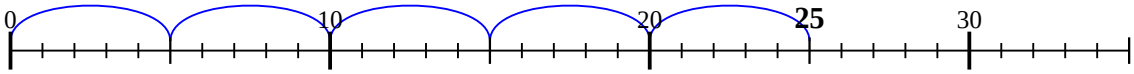


**8)** 20 ÷ 5 =

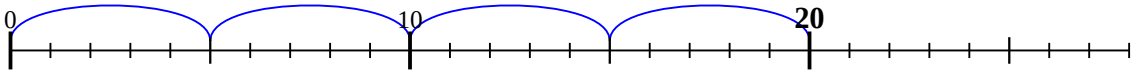


**9)** 32 ÷ 8 =

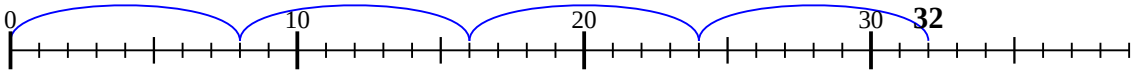


**10)** 6 ÷ 2 =

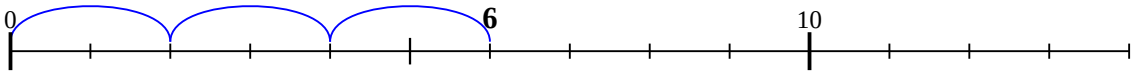


**11)** 12 ÷ 4 =

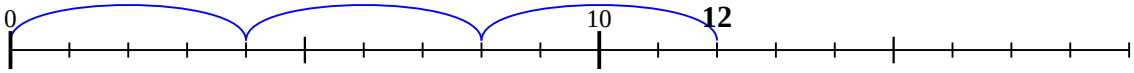


## Réponses

1. **4**
2. **2**
3. **5**
4. **5**
5. **4**
6. **3**
7. **5**
8. **4**
9. **4**
10. **3**
11. **3**



| | | | | | | | | | | |
|---|---|---|---|---|---|---|---|---|---|---|
| 1-10 | 91 | 82 | 73 | 64 | 55 | 45 | 36 | 27 | 18 | 9 |
| 11 | 0 | | | | | | | | | |