Compter des Figures

Nom:

Comptez le nombre de figure de chaque boîte.



= 6

 = _____

= _____

= _____

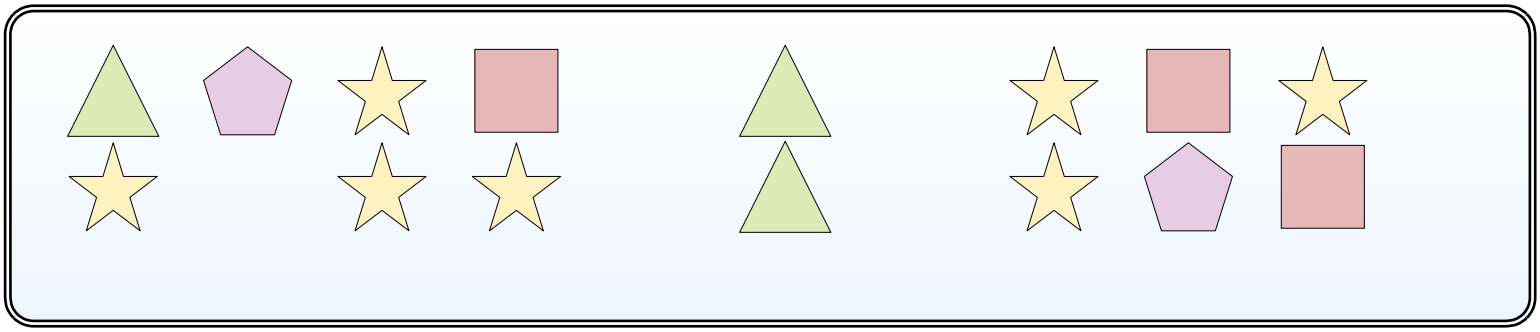

= _____

= _____

= _____

= _____



= _____

= _____

= _____

= _____

1-10	91	82	73	64	55	45	36	27	18	9
11	0									

Compter des Figures

Nom: **Clé**

Comptez le nombre de figure de chaque boîte.



= 6

 = 3

= 5

= 5

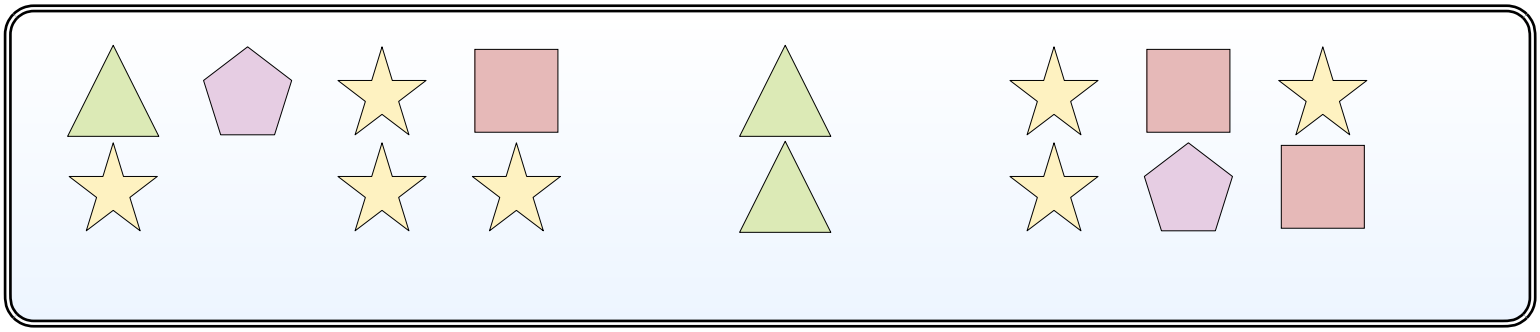

= 3

= 2

= 7

= 3



= 6

= 7

= 1

= 5

1-10	91	82	73	64	55	45	36	27	18	9
11	0									